Test Bank for Linear Algebra and its Applications 6th Lay

Access Complete Test Bank for Linear Algebra and its Applications 6th Lay

MULTIPLE CHOICE. Choose the one alternative that best completes the statement or answers the question.

Solve the system of equations.

1) $x_1 - x_2 + 3x_3 = -8$
$2x_1 + x_3 = 0$
$x_1 + 5x_2 + x_3 = 40$

A) (8, 8, 0) B) (0, –8, –8) C) (0, 8, 0) D) (–8, 0, 0)

Answer: C

2) $x_1 + 3x_2 + 2x_3 = 11$
$4x_2 + 9x_3 = -12$
$x_3 = -4$

A) (1, 6, –4) B) (–4, 6, 1) C) (1, –4, 6) D) (–4, 1, 6)

Answer: A

3) $x_1 - x_2 + 8x_3 = -107$
$6x_1 + x_3 = 17$
$3x_2 - 5x_3 = 89$

A) (–5, 8, 13) B) (5, 8, –13) C) (5, –8, –13) D) (–5, –8, 13)

Answer: B

4) $4x_1 - x_2 + 3x_3 = 12$
$2x_1 + 9x_3 = -5$
$x_1 + 4x_2 + 6x_3 = -32$

A) (2, –7, 1) B) (2, 7, 1) C) (2, 7, –1) D) (2, –7, –1)

Answer: D

5) $x_1 + x_2 + x_3 = 6$
$x_1 - x_3 = -2$
$x_2 + 3x_3 = 11$

A) (0, 1, 2) B) (–1, 2, –3) C) (1, 2, 3) D) No solution

Answer: C

6) $x_1 + x_2 + x_3 = 7$
$x_1 - x_2 + 2x_3 = 7$
$5x_1 + x_2 + x_3 = 11$

A) (4, 2, 1) B) (4, 1, 2) C) (1, 2, 4) D) (1, 4, 2)

Answer: C

7) $x_1 - x_2 + x_3 = 8$
$x_1 + x_2 + x_3 = 6$
$x_1 + x_2 - x_3 = -12$

A) (2, –1, 9) B) (2, –1, –9) C) (–2, –1, –9) D) (–2, –1, 9)

Answer: D

Access Complete Test Bank for Linear Algebra and its Applications 6th Lay

8) $5x_1 + 2x_2 + x_3 = -11$
$2x_1 - 3x_2 - x_3 = 17$
$7x_1 + x_2 + 2x_3 = -4$
A) (3, 0, –4) B) (0, –6, 1) C) (0, 6, –1) D) (–3, 0, 4)
Answer: B

9) $7x_1 + 7x_2 + x_3 = 1$
$x_1 + 8x_2 + 8x_3 = 8$
$9x_1 + x_2 + 9x_3 = 9$
A) (0, 1, 0) B) (1, –1, 1) C) (–1, 1, 1) D) (0, 0, 1)
Answer: D

10) $2x_1 + x_2 = 0$
$x_1 - 3x_2 + x_3 = 0$
$3x_1 + x_2 - x_3 = 0$
A) (0, 0, 0) B) (0, 1, 0) C) No solution D) (1, 0, 0)
Answer: A

Determine whether the system is consistent.

11) $x_1 + x_2 + x_3 = 7$
$x_1 - x_2 + 2x_3 = 7$
$5x_1 + x_2 + x_3 = 11$
A) Yes B) No
Answer: A

12) $5x_1 + 2x_2 + x_3 = -11$
$2x_1 - 3x_2 - x_3 = 17$
$7x_1 + x_2 + 2x_3 = -4$
A) Yes B) No
Answer: A

13) $4x_1 - x_2 + 3x_3 = 12$
$2x_1 + 9x_3 = -5$
$x_1 + 4x_2 + 6x_3 = -32$
A) Yes B) No
Answer: A

14) $2x_1 + x_2 = 0$
$x_1 - 3x_2 + x_3 = 0$
$3x_1 + x_2 - x_3 = 0$
A) Yes B) No
Answer: A

Access Complete Test Bank for Linear Algebra and its Applications 6th Lay

15) $x_1 + x_2 + x_3 = 6$
$x_1 - x_3 = -2$
$x_2 + 3x_3 = 11$
A) No B) Yes
Answer: B

16) $x_1 - x_2 + 3x_3 = -11$
$-4x_1 + 4x_2 - 12x_3 = -2$
$x_1 + 3x_2 + x_3 = -17$
A) Yes B) No
Answer: B

17) $x_1 + x_2 + x_3 = 7$
$x_1 - x_2 + 2x_3 = 7$
$2x_1 + 3x_3 = 15$
A) Yes B) No
Answer: B

18) $x_1 + 3x_2 + 2x_3 = 11$
$4x_2 + 9x_3 = -12$
$x_1 + 7x_2 + 11x_3 = -11$
A) Yes B) No
Answer: B

19) $5x_1 + 2x_2 + x_3 = -11$
$2x_1 - 3x_2 - x_3 = 17$
$7x_1 - x_2 = 12$
A) No B) Yes
Answer: A

20) $5x_2 + x_4 = -21$
$x_1 + x_2 + 4x_3 - x_4 = 4$
$5x_1 + x_3 + 4x_4 = 12$
$x_1 + x_2 + 6x_3 = 5$
A) No B) Yes
Answer: B

Determine whether the matrix is in echelon form, reduced echelon form, or neither.

21) $\begin{bmatrix} 1 & 3 & 5 & -7 \\ 0 & 1 & -4 & -4 \\ 0 & 0 & 1 & 6 \end{bmatrix}$

A) Reduced echelon form B) Echelon form C) Neither
Answer: B

Access Complete Test Bank for Linear Algebra and its Applications 6th Lay

22) $\begin{bmatrix} 1 & 4 & 5 & -7 \\ 0 & 1 & -4 & -5 \\ 0 & 6 & 1 & 4 \end{bmatrix}$

A) Echelon form B) Reduced echelon form C) Neither

Answer: C

23) $\begin{bmatrix} 1 & 4 & 5 & -7 \\ 3 & 1 & -4 & -6 \\ 0 & 4 & 1 & 3 \end{bmatrix}$

A) Reduced echelon form B) Echelon form C) Neither

Answer: C

24) $\begin{bmatrix} 1 & 0 & 0 & -7 \\ 1 & 1 & 0 & 1 \\ 0 & 3 & 1 & 1 \end{bmatrix}$

A) Echelon form B) Reduced echelon form C) Neither

Answer: C

25) $\begin{bmatrix} 1 & 4 & 1 & -7 \\ 0 & 1 & -4 & 7 \\ 0 & 0 & 0 & 0 \end{bmatrix}$

A) Neither B) Echelon form C) Reduced echelon form

Answer: B

26) $\begin{bmatrix} 1 & 0 & 5 & -4 \\ 0 & 1 & -5 & -2 \\ 0 & 0 & 0 & 0 \\ 0 & 0 & 0 & 0 \end{bmatrix}$

A) Echelon form B) Reduced echelon form C) Neither

Answer: B

27) $\begin{bmatrix} 1 & -5 & -5 & -5 \\ 0 & 0 & -2 & 3 \\ 0 & 0 & 0 & -3 \\ 0 & 0 & 0 & 0 \end{bmatrix}$

A) Neither B) Reduced echelon form C) Echelon form

Answer: C

Access Complete Test Bank for Linear Algebra and its Applications 6th Lay

Use the row reduction algorithm to transform the matrix into echelon form or reduced echelon form as indicated.

28) Find the echelon form of the given matrix.

$$\begin{bmatrix} 1 & 4 & -2 & 3 \\ -3 & -11 & 9 & -5 \\ -2 & 4 & -3 & 4 \end{bmatrix}$$

A) $\begin{bmatrix} 1 & 4 & -2 & 3 \\ 0 & 1 & 3 & 4 \\ 0 & 12 & -7 & 10 \end{bmatrix}$

B) $\begin{bmatrix} 1 & 4 & -2 & 3 \\ 0 & 1 & 3 & 4 \\ 0 & 0 & -43 & -38 \end{bmatrix}$

C) $\begin{bmatrix} 1 & 4 & -2 & 3 \\ 0 & 1 & 3 & 4 \\ 0 & 0 & -43 & 0 \end{bmatrix}$

D) $\begin{bmatrix} 1 & 4 & -2 & 3 \\ 0 & 1 & 3 & 4 \\ 0 & 0 & -19 & -2 \end{bmatrix}$

Answer: B

29) Find the reduced echelon form of the given matrix.

$$\begin{bmatrix} 1 & 4 & -5 & 1 & 2 \\ 2 & 5 & -4 & -1 & 4 \\ -3 & -9 & 9 & 2 & 2 \end{bmatrix}$$

A) $\begin{bmatrix} 1 & 4 & -5 & 0 & -2 \\ 0 & 1 & -2 & 0 & -4 \\ 0 & 0 & 0 & 1 & 4 \end{bmatrix}$

B) $\begin{bmatrix} 1 & 0 & 0 & 0 & 14 \\ 0 & 1 & 0 & 0 & -4 \\ 0 & 0 & 0 & 1 & 4 \end{bmatrix}$

C) $\begin{bmatrix} 1 & 4 & -5 & 1 & 2 \\ 0 & 1 & -2 & 1 & 0 \\ 0 & 0 & 0 & 1 & 4 \end{bmatrix}$

D) $\begin{bmatrix} 1 & 0 & 3 & 0 & 14 \\ 0 & 1 & -2 & 0 & -4 \\ 0 & 0 & 0 & 1 & 4 \end{bmatrix}$

Answer: D

The augmented matrix is given for a system of equations. If the system is consistent, find the general solution. Otherwise state that there is no solution.

30) $\begin{bmatrix} 1 & -5 & -1 \\ 0 & 0 & 3 \end{bmatrix}$

A) (–1, 3)

B) $x_1 = -1 + 5x_2$
x_2 is free

C) $x_1 = -1 + 5x_2$
$x_2 = 3$
x_3 is free

D) No solution

Answer: D

31) $\begin{bmatrix} 1 & 2 & -3 & -9 \\ 0 & 1 & 4 & 5 \\ 0 & 0 & 0 & 1 \end{bmatrix}$

A) $x_1 = -19 + 11x_3$
$x_2 = 5 - 4x_3$
$x_3 = 1$

B) No solution

C) $x_1 = -9 - 2x_2 + 3x_3$
x_2 is free
x_3 is free

D) $x_1 = -19 + 11x_3$
$x_2 = 5 - 4x_3$
x_3 is free

Answer: B

32) $\begin{bmatrix} 1 & 2 & -3 & 6 \\ 0 & 1 & 4 & -7 \\ 0 & 0 & 0 & 0 \end{bmatrix}$

A) $x_1 = 6 - 2x_2 + 3x_3$
$x_2 = -7 - 4x_3$
x_3 is free

B) $x_1 = 6 - 2x_2 + 3x_3$
x_2 is free
x_3 is free

C) $x_1 = 20 + 11x_3$
$x_2 = -7 - 4x_3$
$x_3 = 0$

D) $x_1 = 20 + 11x_3$
$x_2 = -7 - 4x_3$
x_3 is free

Answer: D

Access Complete Test Bank for Linear Algebra and its Applications 6th Lay

33) $\begin{bmatrix} 1 & 0 & 6 & 2 \\ 0 & 1 & -2 & -3 \\ 0 & 0 & 0 & 0 \end{bmatrix}$

A) $x_1 = 2 - 6x_3$
$x_2 = -3 + 2x_3$
$x_3 = 0$

B) No solution

C) $x_1 = 2 - 6x_3$
$x_2 = -3 + 2x_3$
x_3 is free

D) $x_1 = 2 - 6x_3$
x_2 is free
$x_3 = \frac{3}{2} + \frac{1}{2}x_2$

Answer: C

34) $\begin{bmatrix} 1 & 4 & -2 & -3 & 1 \\ 0 & 0 & 1 & 4 & -4 \\ -1 & -4 & -1 & -9 & 11 \end{bmatrix}$

A) $x_1 = -4x_2 + 2x_3 + 3x_4 + 1$
x_2 is free
$x_3 = -4 - 4x_4$
x_4 is free

B) $x_1 = -7 - 4x_2 - 5x_3$
$x_2 = -4 - 4x_3$
x_3 is free

C) $x_1 = -7 - 4x_2 - 5x_4$
x_2 is free
$x_3 = -4 - 4x_4$
$x_4 = 0$

D) $x_1 = -7 - 4x_2 - 5x_4$
x_2 is free
$x_3 = -4 - 4x_4$
x_4 is free

Answer: D

35) $\begin{bmatrix} 1 & 6 & 3 & -1 & 2 & 6 \\ 0 & 0 & 0 & -4 & 3 & 4 \\ 0 & 0 & 0 & 0 & -2 & 8 \end{bmatrix}$

A) No solution

B) $x_1 = -6x_2 - 3x_3 + x_4 - 2x_5 + 6$
x_2 is free
x_3 is free
$x_4 = \frac{3}{4}x_5 - 1$
$x_5 = -4$

C) $x_1 = -6x_2 - 3x_3 + 10$
x_2 is free
x_3 is free
$x_4 = -4$
$x_5 = -4$

D) $x_1 = -6x_2 - 3x_3 + 10$
x_2 is free
$x_3 = -4$
$x_4 = \frac{3}{4}x_5 - 1$
$x_5 = -4$

Answer: C

Access Complete Test Bank for Linear Algebra and its Applications 6th Lay

Find the indicated vector.

36) Let $\mathbf{u} = \begin{bmatrix} -6 \\ 4 \end{bmatrix}$, $\mathbf{v} = \begin{bmatrix} 2 \\ 1 \end{bmatrix}$. Find $\mathbf{u} + \mathbf{v}$.

A) $\begin{bmatrix} -8 \\ 3 \end{bmatrix}$ B) $\begin{bmatrix} -2 \\ 3 \end{bmatrix}$ C) $\begin{bmatrix} -5 \\ 6 \end{bmatrix}$ D) $\begin{bmatrix} -4 \\ 5 \end{bmatrix}$

Answer: D

37) Let $\mathbf{u} = \begin{bmatrix} 9 \\ -8 \end{bmatrix}$, $\mathbf{v} = \begin{bmatrix} 7 \\ 2 \end{bmatrix}$. Find $\mathbf{u} - \mathbf{v}$.

A) $\begin{bmatrix} 7 \\ -15 \end{bmatrix}$ B) $\begin{bmatrix} 2 \\ -10 \end{bmatrix}$ C) $\begin{bmatrix} 17 \\ 5 \end{bmatrix}$ D) $\begin{bmatrix} 16 \\ -6 \end{bmatrix}$

Answer: B

38) Let $\mathbf{u} = \begin{bmatrix} -5 \\ 5 \end{bmatrix}$, $\mathbf{v} = \begin{bmatrix} 1 \\ 6 \end{bmatrix}$. Find $\mathbf{v} - \mathbf{u}$.

A) $\begin{bmatrix} 11 \\ -4 \end{bmatrix}$ B) $\begin{bmatrix} 6 \\ 1 \end{bmatrix}$ C) $\begin{bmatrix} -4 \\ 11 \end{bmatrix}$ D) $\begin{bmatrix} 10 \\ 5 \end{bmatrix}$

Answer: B

39) Let $\mathbf{u} = \begin{bmatrix} 3 \\ 2 \end{bmatrix}$. Find $4\mathbf{u}$.

A) $\begin{bmatrix} -12 \\ -8 \end{bmatrix}$ B) $\begin{bmatrix} -12 \\ 8 \end{bmatrix}$ C) $\begin{bmatrix} 12 \\ 8 \end{bmatrix}$ D) $\begin{bmatrix} 12 \\ -8 \end{bmatrix}$

Answer: C

40) Let $\mathbf{u} = \begin{bmatrix} 8 \\ -6 \end{bmatrix}$. Find $3\mathbf{u}$.

A) $\begin{bmatrix} 24 \\ -18 \end{bmatrix}$ B) $\begin{bmatrix} -24 \\ -18 \end{bmatrix}$ C) $\begin{bmatrix} -24 \\ 18 \end{bmatrix}$ D) $\begin{bmatrix} 24 \\ 18 \end{bmatrix}$

Answer: A

41) Let $\mathbf{u} = \begin{bmatrix} -6 \\ -7 \end{bmatrix}$. Find $-2\mathbf{u}$.

A) $\begin{bmatrix} 12 \\ 14 \end{bmatrix}$ B) $\begin{bmatrix} -12 \\ 14 \end{bmatrix}$ C) $\begin{bmatrix} -12 \\ -14 \end{bmatrix}$ D) $\begin{bmatrix} 12 \\ -14 \end{bmatrix}$

Answer: A

42) Let $\mathbf{u} = \begin{bmatrix} -7 \\ 5 \end{bmatrix}$. Find $-5\mathbf{u}$.

A) $\begin{bmatrix} 35 \\ -25 \end{bmatrix}$ B) $\begin{bmatrix} -35 \\ -25 \end{bmatrix}$ C) $\begin{bmatrix} 35 \\ 25 \end{bmatrix}$ D) $\begin{bmatrix} -35 \\ 25 \end{bmatrix}$

Answer: A

Access Complete Test Bank for Linear Algebra and its Applications 6th Lay

43) Let $\mathbf{u} = \begin{bmatrix} 2 \\ 1 \end{bmatrix}$, $\mathbf{v} = \begin{bmatrix} 7 \\ -5 \end{bmatrix}$. Find $-5\mathbf{u} + 2\mathbf{v}$.

A) $\begin{bmatrix} -45 \\ -8 \end{bmatrix}$ B) $\begin{bmatrix} 4 \\ -15 \end{bmatrix}$ C) $\begin{bmatrix} -24 \\ 5 \end{bmatrix}$ D) $\begin{bmatrix} -15 \\ 4 \end{bmatrix}$

Answer: B

Display the indicated vector(s) on an xy–graph.

44) Let $\mathbf{u} = \begin{bmatrix} -3 \\ 5 \end{bmatrix}$ and $\mathbf{v} = \begin{bmatrix} -2 \\ 2 \end{bmatrix}$. Display the vectors **u**, **v**, and **u + v** on the same axes.

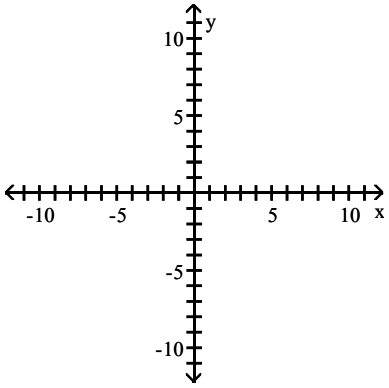

A)

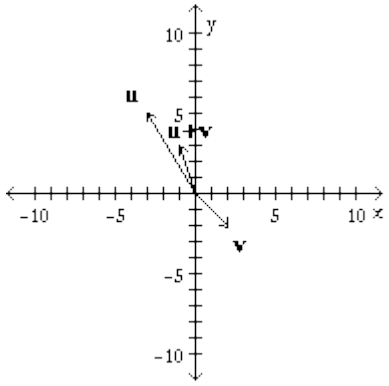

B)

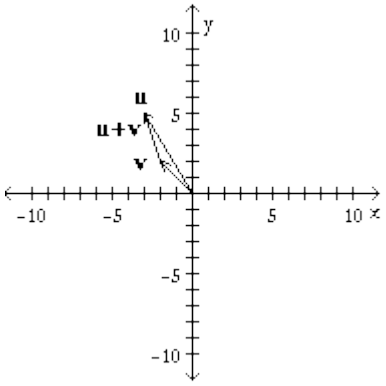

C)

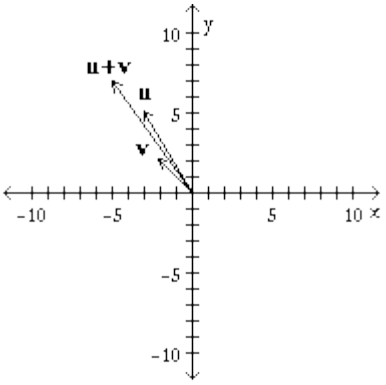

D)

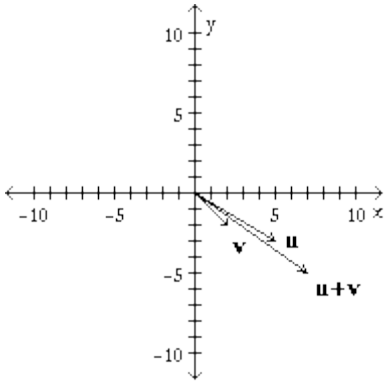

Answer: C

Access Complete Test Bank for Linear Algebra and its Applications 6th Lay

45) Let $\mathbf{u} = \begin{bmatrix} 5 \\ -4 \end{bmatrix}$ Display the vector $\mathbf{2u}$ using the given axes.

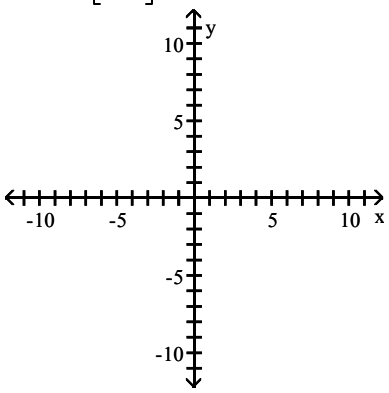

A)

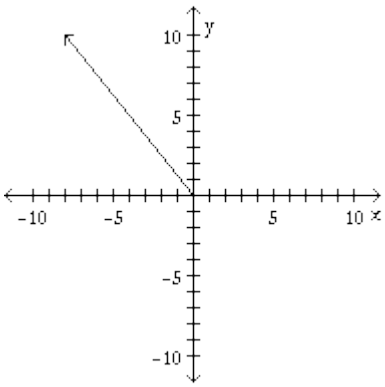

B)

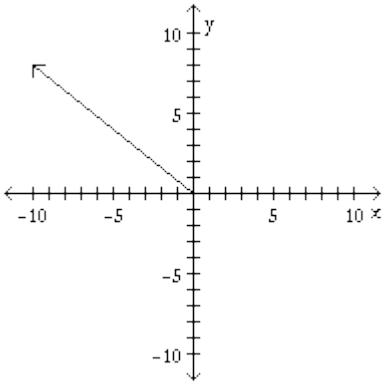

C)

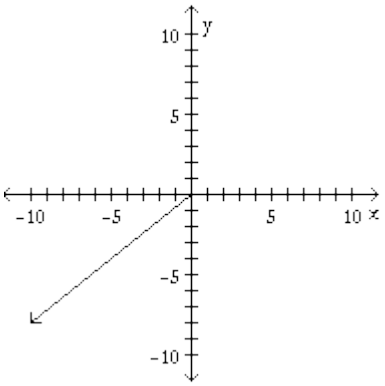

D)

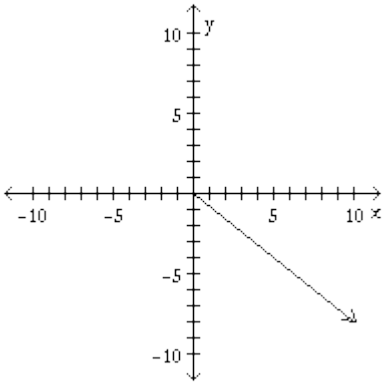

Answer: D

Solve the problem.

46) Let $\mathbf{a_1} = \begin{bmatrix} 6 \\ 1 \\ -1 \end{bmatrix}$, $\mathbf{a_2} = \begin{bmatrix} -5 \\ 1 \\ 6 \end{bmatrix}$, and $\mathbf{b} = \begin{bmatrix} -39 \\ -1 \\ 22 \end{bmatrix}$.

Determine whether $\mathbf{b}$ can be written as a linear combination of $\mathbf{a_1}$ and $\mathbf{a_2}$. In other words, determine whether weights x_1 and x_2 exist, such that $x_1\,\mathbf{a_1} + x_2\,\mathbf{a_2} = \mathbf{b}$. Determine the weights x_1 and x_2 if possible.

A) $x_1 = -4, x_2 = 4$ B) $x_1 = -4, x_2 = 3$ C) $x_1 = -3, x_2 = 2$ D) No solution

Answer: B

Access Complete Test Bank for Linear Algebra and its Applications 6th Lay

47) Let $\mathbf{a_1} = \begin{bmatrix} 1 \\ 2 \\ -3 \end{bmatrix}$, $\mathbf{a_2} = \begin{bmatrix} -3 \\ -4 \\ 1 \end{bmatrix}$, $\mathbf{a_3} = \begin{bmatrix} 2 \\ 1 \\ 6 \end{bmatrix}$, and $\mathbf{b} = \begin{bmatrix} -3 \\ 6 \\ -1 \end{bmatrix}$.

Determine whether $\mathbf{b}$ can be written as a linear combination of $\mathbf{a_1}$, $\mathbf{a_2}$, and $\mathbf{a_3}$. In other words, determine whether weights x_1, x_2, and x_3 exist, such that $x_1\,\mathbf{a_1} + x_2\,\mathbf{a_2} + x_3\,\mathbf{a_3} = \mathbf{b}$. Determine the weights x_1, x_2, and x_3 if possible.

A) No solution

B) $x_1 = -5, x_2 = 0, x_3 = 1$

C) $x_1 = -2, x_2 = -1, x_3 = 6$

D) $x_1 = 2, x_2 = 1, x_3 = -1$

Answer: A

SHORT ANSWER. Write the word or phrase that best completes each statement or answers the question.

48) A company manufactures two products. For $1.00 worth of product A, the company spends $0.50 on materials, $0.20 on labor, and $0.10 on overhead. For $1.00 worth of product B, the company spends $0.40 on materials, $0.20 on labor, and $0.10 on overhead. Let

$$\mathbf{a} = \begin{bmatrix} 0.50 \\ 0.20 \\ 0.10 \end{bmatrix} \text{ and } \mathbf{b} = \begin{bmatrix} 0.40 \\ 0.20 \\ 0.10 \end{bmatrix}.$$

Then $\mathbf{a}$ and $\mathbf{b}$ represent the "costs per dollar of income" for the two products.
Evaluate $500\mathbf{a} + 100\mathbf{b}$ and give an economic interpretation of the result.

Answer: $500\mathbf{a} + 100\mathbf{b} = \begin{bmatrix} 290 \\ 120 \\ 60 \end{bmatrix}$

$500\mathbf{a} + 100\mathbf{b}$ lists the various costs for producing $500 worth of product A and $100 worth of product B, namely $290 for materials, $120 for labor, and $60 for overhead.

Access Complete Test Bank for Linear Algebra and its Applications 6th Lay

49) A company manufactures two products. For $1.00 worth of product A, the company spends $0.45 on materials, $0.20 on labor, and $0.10 on overhead. For $1.00 worth of product B, the company spends $0.40 on materials, $0.20 on labor, and $0.10 on overhead. Let

$$\mathbf{a} = \begin{bmatrix} 0.45 \\ 0.20 \\ 0.10 \end{bmatrix} \text{ and } \mathbf{b} = \begin{bmatrix} 0.40 \\ 0.20 \\ 0.10 \end{bmatrix}.$$

Then **a** and **b** represent the "costs per dollar of income" for the two products.
Suppose the company manufactures x_1 dollars worth of product A and x_2 dollars worth of product B and that its total costs for materials are $205, its total costs for labor are $100, and its total costs for overhead are $50.
Determine x_1 and x_2, the dollars worth of each product produced. Include a vector equation as part of your solution.

Answer: $x_1\mathbf{a} + x_2\mathbf{b} = \begin{bmatrix} 205 \\ 100 \\ 50 \end{bmatrix}$

or

$$x_1 \begin{bmatrix} 0.45 \\ 0.20 \\ 0.10 \end{bmatrix} + x_2 \begin{bmatrix} 0.40 \\ 0.20 \\ 0.10 \end{bmatrix} = \begin{bmatrix} 205 \\ 100 \\ 50 \end{bmatrix}$$

$x_1 = 100, x_2 = 400$

MULTIPLE CHOICE. Choose the one alternative that best completes the statement or answers the question.

Compute the product or state that it is undefined.

50) $\begin{bmatrix} -7 & 2 & 7 \end{bmatrix} \begin{bmatrix} 9 \\ 0 \\ -3 \end{bmatrix}$

A) $\begin{bmatrix} -63 \\ 0 \\ -21 \end{bmatrix}$ B) $[-84]$ C) $[-63 \;\; 0 \;\; -21]$ D) $[435]$

Answer: B

51) $\begin{bmatrix} -1 & 1 & -2 \\ -8 & 2 & -6 \end{bmatrix} \begin{bmatrix} 5 \\ 9 \\ 9 \end{bmatrix}$

A) $[-14 \;\; -76]$ B) $\begin{bmatrix} -1 & 1 & -2 \\ -8 & 2 & -6 \\ 5 & 9 & 9 \end{bmatrix}$ C) $\begin{bmatrix} -14 \\ -76 \end{bmatrix}$ D) $\begin{bmatrix} -76 \\ -14 \end{bmatrix}$

Answer: C

Access Complete Test Bank for Linear Algebra and its Applications 6th Lay

52)
$$\begin{bmatrix} 3 & -7 \\ 8 & -4 \\ -4 & 1 \end{bmatrix}\begin{bmatrix} -4 \\ 5 \end{bmatrix}$$

A) Undefined

B) $\begin{bmatrix} -47 \\ -52 \\ 21 \end{bmatrix}$

C) $\begin{bmatrix} -12 & 40 \\ 28 & -20 \\ -4 & 1 \end{bmatrix}$

D) $\begin{bmatrix} -12 & -35 \\ -32 & -20 \\ 16 & 5 \end{bmatrix}$

Answer: B

53)
$$\begin{bmatrix} -4 & 8 \\ 1 & 5 \\ 2 & 8 \end{bmatrix}\begin{bmatrix} 1 \\ -5 \\ 7 \end{bmatrix}$$

A) Undefined

B) $\begin{bmatrix} -4 & 8 \\ -5 & -25 \\ 14 & 56 \end{bmatrix}$

C) $\begin{bmatrix} 5 & 39 \end{bmatrix}$

D) $\begin{bmatrix} 4 \\ -30 \\ 70 \end{bmatrix}$

Answer: A

Write the system as a vector equation or matrix equation as indicated.

54) Write the following system as a vector equation involving a linear combination of vectors.

$$\begin{aligned} 5x_1 - 2x_2 - x_3 &= 2 \\ 4x_1 + \quad 3x_3 &= -1 \end{aligned}$$

A) $x_1\begin{bmatrix} 5 \\ 2 \\ -1 \end{bmatrix} + x_2\begin{bmatrix} 4 \\ 0 \\ 3 \end{bmatrix} = \begin{bmatrix} 2 \\ -1 \\ 0 \end{bmatrix}$

B) $x_1\begin{bmatrix} 5 \\ 4 \end{bmatrix} + x_2\begin{bmatrix} -2 \\ 0 \end{bmatrix} + x_3\begin{bmatrix} -1 \\ 3 \end{bmatrix} = \begin{bmatrix} 2 \\ -1 \end{bmatrix}$

C) $5\begin{bmatrix} x_1 \\ x_2 \\ x_3 \end{bmatrix} - 2\begin{bmatrix} x_1 \\ x_2 \\ x_3 \end{bmatrix} - \begin{bmatrix} x_1 \\ x_2 \\ x_3 \end{bmatrix} = \begin{bmatrix} 2 \\ -1 \\ 0 \end{bmatrix}$

D) $x_1\begin{bmatrix} 5 \\ 4 \end{bmatrix} + x_2\begin{bmatrix} -2 \\ 1 \end{bmatrix} + x_3\begin{bmatrix} 1 \\ 3 \end{bmatrix} = \begin{bmatrix} 2 \\ -1 \end{bmatrix}$

Answer: B

55) Write the following system as a matrix equation involving the product of a matrix and a vector on the left side and a vector on the right side.

$$\begin{aligned} 3x_1 + x_2 - 2x_3 &= -4 \\ 2x_1 - 2x_2 \quad &= 1 \end{aligned}$$

A) $\begin{bmatrix} x_1 & x_2 & x_3 \\ 2 & -2 & 0 \end{bmatrix}\begin{bmatrix} 3 \\ 1 \\ -2 \end{bmatrix} = \begin{bmatrix} -4 \\ 1 \end{bmatrix}$

B) $\begin{bmatrix} 3 & 1 & -2 \\ 2 & 2 & 1 \end{bmatrix}\begin{bmatrix} x_1 \\ x_2 \\ x_3 \end{bmatrix} = \begin{bmatrix} -4 \\ 1 \end{bmatrix}$

C) $\begin{bmatrix} 3 & 1 & -2 \\ 2 & -2 & 0 \end{bmatrix}\begin{bmatrix} x_1 \\ x_2 \\ x_3 \end{bmatrix} = \begin{bmatrix} -4 \\ 1 \end{bmatrix}$

D) $\begin{bmatrix} 3 & 2 \\ 1 & -2 \\ -2 & 0 \end{bmatrix}\begin{bmatrix} x_1 \\ x_2 \end{bmatrix} = \begin{bmatrix} -4 \\ 1 \end{bmatrix}$

Answer: C

Access Complete Test Bank for Linear Algebra and its Applications 6th Lay

Solve the problem.

56) Let $A = \begin{bmatrix} 1 & -3 & 2 \\ -2 & 5 & -1 \\ 3 & -4 & -7 \end{bmatrix}$ and $\mathbf{b} = \begin{bmatrix} b_1 \\ b_2 \\ b_3 \end{bmatrix}$.

Determine if the equation $Ax = b$ is consistent for all possible b_1, b_2, b_3. If the equation is not consistent for all possible b_1, b_2, b_3, give a description of the set of all **b** for which the equation is consistent (i.e., a condition which must be satisfied by b_1, b_2, b_3).

A) Equation is consistent for all possible b_1, b_2, b_3.

B) Equation is consistent for all b_1, b_2, b_3 satisfying $2b_1 + b_2 = 0$.

C) Equation is consistent for all b_1, b_2, b_3 satisfying $7b_1 + 5b_2 + b_3 = 0$.

D) Equation is consistent for all b_1, b_2, b_3 satisfying $-3b_1 + b_3 = 0$.

Answer: A

57) Let $A = \begin{bmatrix} 1 & -3 & 2 \\ -2 & 5 & -1 \\ 3 & -3 & -12 \end{bmatrix}$ and $\mathbf{b} = \begin{bmatrix} b_1 \\ b_2 \\ b_3 \end{bmatrix}$.

Determine if the equation $Ax = b$ is consistent for all possible b_1, b_2, b_3. If the equation is not consistent for all possible b_1, b_2, b_3, give a description of the set of all **b** for which the equation is consistent (i.e., a condition which must be satisfied by b_1, b_2, b_3).

A) Equation is consistent for all b_1, b_2, b_3 satisfying $-3b_1 + b_3 = 0$.

B) Equation is consistent for all b_1, b_2, b_3 satisfying $-b_1 + b_2 + b_3 = 0$.

C) Equation is consistent for all b_1, b_2, b_3 satisfying $9b_1 + 6b_2 + b_3 = 0$.

D) Equation is consistent for all possible b_1, b_2, b_3.

Answer: C

58) Find the general solution of the simple homogeneous "system" below, which consists of a single linear equation. Give your answer as a linear combination of vectors. Let x_2 and x_3 be free variables.

$-2x_1 - 8x_2 + 16x_3 = 0$

A) $\begin{bmatrix} x_1 \\ x_2 \\ x_3 \end{bmatrix} = x_2 \begin{bmatrix} 4 \\ 1 \\ 0 \end{bmatrix} + x_3 \begin{bmatrix} -8 \\ 0 \\ 1 \end{bmatrix}$ (with x_2, x_3 free)

B) $\begin{bmatrix} x_1 \\ x_2 \\ x_3 \end{bmatrix} = -4 \begin{bmatrix} x_1 \\ x_2 \\ x_3 \end{bmatrix} - 8 \begin{bmatrix} x_1 \\ x_2 \\ x_3 \end{bmatrix}$ (with x_2, x_3 free)

C) $\begin{bmatrix} x_1 \\ x_2 \\ x_3 \end{bmatrix} = x_2 \begin{bmatrix} -4 \\ 0 \\ 1 \end{bmatrix} + x_3 \begin{bmatrix} 8 \\ 1 \\ 0 \end{bmatrix}$ (with x_2, x_3 free)

D) $\begin{bmatrix} x_1 \\ x_2 \\ x_3 \end{bmatrix} = x_2 \begin{bmatrix} -4 \\ 1 \\ 0 \end{bmatrix} + x_3 \begin{bmatrix} 8 \\ 0 \\ 1 \end{bmatrix}$ (with x_2, x_3 free)

Answer: D

Access Complete Test Bank for Linear Algebra and its Applications 6th Lay

59) Find the general solution of the homogeneous system below. Give your answer as a vector.

$$x_1 + 2x_2 - 3x_3 = 0$$
$$4x_1 + 7x_2 - 9x_3 = 0$$
$$-x_1 - 4x_2 + 9x_3 = 0$$

A) $\begin{bmatrix} x_1 \\ x_2 \\ x_3 \end{bmatrix} = x_3 \begin{bmatrix} -3 \\ 3 \\ 0 \end{bmatrix}$

B) $\begin{bmatrix} x_1 \\ x_2 \\ x_3 \end{bmatrix} = x_3 \begin{bmatrix} 3 \\ -3 \\ 1 \end{bmatrix}$

C) $\begin{bmatrix} x_1 \\ x_2 \\ x_3 \end{bmatrix} = x_3 \begin{bmatrix} -3 \\ 3 \\ 1 \end{bmatrix}$

D) $\begin{bmatrix} x_1 \\ x_2 \\ x_3 \end{bmatrix} = \begin{bmatrix} -3 \\ 3 \\ 1 \end{bmatrix}$

Answer: C

60) Describe all solutions of $A\mathbf{x} = \mathbf{b}$, where

$$A = \begin{bmatrix} 2 & -5 & 3 \\ -2 & 6 & -5 \\ -4 & 7 & 0 \end{bmatrix} \text{ and } \mathbf{b} = \begin{bmatrix} -5 \\ 2 \\ 19 \end{bmatrix}.$$

Describe the general solution in parametric vector form.

A) $\begin{bmatrix} x_1 \\ x_2 \\ x_3 \end{bmatrix} = \begin{bmatrix} -10 \\ -3 \\ 0 \end{bmatrix} + x_3 \begin{bmatrix} 7/2 \\ 2 \\ 1 \end{bmatrix}$

B) $\begin{bmatrix} x_1 \\ x_2 \\ x_3 \end{bmatrix} = \begin{bmatrix} -5 \\ -3 \\ 0 \end{bmatrix} + x_3 \begin{bmatrix} -1 \\ 2 \\ 1 \end{bmatrix}$

C) $\begin{bmatrix} x_1 \\ x_2 \\ x_3 \end{bmatrix} = \begin{bmatrix} 7/2 \\ 2 \\ 1 \end{bmatrix} + x_3 \begin{bmatrix} -10 \\ -3 \\ 0 \end{bmatrix}$

D) $\begin{bmatrix} x_1 \\ x_2 \\ x_3 \end{bmatrix} = \begin{bmatrix} -10 \\ -3 \\ 0 \end{bmatrix} + x_3 \begin{bmatrix} 7/2 \\ 2 \\ 0 \end{bmatrix}$

Answer: A

61) Suppose an economy consists of three sectors: Energy (E), Manufacturing (M), and Agriculture (A).
Sector E sells 70% of its output to M and 30% to A.
Sector M sells 30% of its output to E, 50% to A, and retains the rest.
Sector A sells 15% of its output to E, 30% to M, and retains the rest.

Denote the prices (dollar values) of the total annual outputs of the Energy, Manufacturing, and Agriculture sectors by p_e, p_m, and p_a, respectively. If possible, find equilibrium prices that make each sector's income match its expenditures.
Find the general solution as a vector, with p_a free.

A) $\begin{bmatrix} p_e \\ p_m \\ p_a \end{bmatrix} = \begin{bmatrix} 0.607\ p_a \\ 0.481\ p_a \\ p_a \end{bmatrix}$

B) $\begin{bmatrix} p_e \\ p_m \\ p_a \end{bmatrix} = \begin{bmatrix} 0.465\ p_a \\ 0.593\ p_a \\ p_a \end{bmatrix}$

C) $\begin{bmatrix} p_e \\ p_m \\ p_a \end{bmatrix} = \begin{bmatrix} 0.356\ p_a \\ 0.686\ p_a \\ p_a \end{bmatrix}$

D) $\begin{bmatrix} p_e \\ p_m \\ p_a \end{bmatrix} = \begin{bmatrix} 0.308\ p_a \\ 0.716\ p_a \\ p_a \end{bmatrix}$

Answer: C

Access Complete Test Bank for Linear Algebra and its Applications 6th Lay

62) The network in the figure shows the traffic flow (in vehicles per hour) over several one–way streets in the downtown area of a certain city during a typical lunch time. Determine the general flow pattern for the network. In other words, find the general solution of the system of equations that describes the flow. In your general solution let x_4 be free.

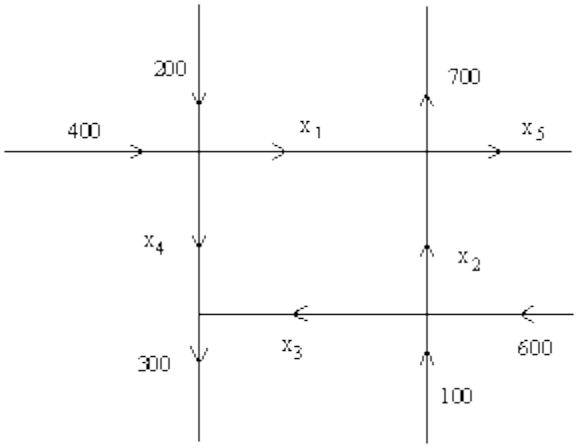

A) $x_1 = 600 - x_4$
$x_2 = 400 - x_4$
$x_3 = 300 + x_4$
x_4 is free
$x_5 = 300$

B) $x_1 = 500 + x_4$
$x_2 = 400 - x_4$
$x_3 = 300 - x_4$
x_4 is free
$x_5 = 200$

C) $x_1 = 600 + x_5$
$x_2 = 400 - x_5$
$x_3 = 300 - x_5$
$x_4 = 300$
x_5 is free

D) $x_1 = 600 - x_4$
$x_2 = 400 + x_4$
$x_3 = 300 - x_4$
x_4 is free
$x_5 = 300$

Answer: D

63) Let $\mathbf{v_1} = \begin{bmatrix} 1 \\ -3 \\ -4 \end{bmatrix}$, $\mathbf{v_2} = \begin{bmatrix} -3 \\ 8 \\ 4 \end{bmatrix}$, $\mathbf{v_3} = \begin{bmatrix} 2 \\ -2 \\ 6 \end{bmatrix}$.

Determine if the set $\{\mathbf{v_1}, \mathbf{v_2}, \mathbf{v_3}\}$ is linearly independent.

A) Yes
B) No

Answer: A

64) Determine if the columns of the matrix $A = \begin{bmatrix} -2 & 1 & 4 \\ 4 & 0 & -4 \\ 2 & 4 & 6 \end{bmatrix}$ are linearly independent.

A) No
B) Yes

Answer: A

65) For what values of h are the given vectors linearly independent?

$\begin{bmatrix} -1 \\ 1 \\ 6 \end{bmatrix}, \begin{bmatrix} -4 \\ 4 \\ h \end{bmatrix}$

A) Vectors are linearly independent for h = 24
B) Vectors are linearly dependent for all h
C) Vectors are linearly independent for all h
D) Vectors are linearly independent for h ≠ 24

Answer: D

Access Complete Test Bank for Linear Algebra and its Applications 6th Lay

66) For what values of h are the given vectors linearly dependent?

$$\begin{bmatrix} -1 \\ 4 \\ 6 \end{bmatrix}, \begin{bmatrix} 5 \\ 2 \\ -3 \end{bmatrix}, \begin{bmatrix} 5 \\ -3 \\ 5 \end{bmatrix}, \begin{bmatrix} -20 \\ 12 \\ h \end{bmatrix}$$

A) Vectors are linearly independent for all h
B) Vectors are linearly dependent for $h \neq -20$
C) Vectors are linearly dependent for $h = -20$
D) Vectors are linearly dependent for all h

Answer: D

67) Let $A = \begin{bmatrix} 2 & 8 & -2 \\ 3 & -5 & -3 \end{bmatrix}$ and $\mathbf{u} = \begin{bmatrix} 2 \\ -1 \\ 1 \end{bmatrix}$.

Define a transformation T: $\mathbb{R}^3 \to \mathbb{R}^2$ by $T(\mathbf{x}) = A\mathbf{x}$. Find $T(\mathbf{u})$, the image of $\mathbf{u}$ under the transformation T.

A) $\begin{bmatrix} 10 \\ -3 \\ -5 \end{bmatrix}$
B) $\begin{bmatrix} -6 \\ 8 \end{bmatrix}$
C) $\begin{bmatrix} 16 \\ 5 \end{bmatrix}$
D) $\begin{bmatrix} 4 & -8 & -2 \\ 6 & 5 & -3 \end{bmatrix}$

Answer: B

68) Let T: $\mathbb{R}^2 \to \mathbb{R}^2$ be a linear transformation that maps $\mathbf{u} = \begin{bmatrix} -3 \\ 6 \end{bmatrix}$ into $\begin{bmatrix} -15 \\ 6 \end{bmatrix}$ and maps $\mathbf{v} = \begin{bmatrix} 6 \\ -6 \end{bmatrix}$ into $\begin{bmatrix} 24 \\ -12 \end{bmatrix}$.

Use the fact that T is linear to find the image of $3\mathbf{u} + \mathbf{v}$.

A) $\begin{bmatrix} 9 \\ -6 \end{bmatrix}$
B) $\begin{bmatrix} -3 \\ 12 \end{bmatrix}$
C) $\begin{bmatrix} -21 \\ 6 \end{bmatrix}$
D) $\begin{bmatrix} 27 \\ -18 \end{bmatrix}$

Answer: C

69) Let $A = \begin{bmatrix} 1 & -3 & 0 \\ -4 & 0 & 2 \\ 2 & -5 & -3 \end{bmatrix}$ and $\mathbf{b} = \begin{bmatrix} 2 \\ 6 \\ 0 \end{bmatrix}$.

Define a transformation T: $\mathbb{R}^3 \to \mathbb{R}^3$ by $T(\mathbf{x}) = A\mathbf{x}$.

If possible, find a vector $\mathbf{x}$ whose image under T is $\mathbf{b}$. Otherwise, state that $\mathbf{b}$ is not in the range of the transformation T.

A) $\mathbf{b}$ is not in the range of the transformation T.
B) $\begin{bmatrix} -1 \\ -1 \\ 0 \end{bmatrix}$
C) $\begin{bmatrix} -1 \\ -1 \\ 1 \end{bmatrix}$
D) $\begin{bmatrix} -1 \\ 1 \\ -1 \end{bmatrix}$

Answer: C

Access Complete Test Bank for Linear Algebra and its Applications 6th Lay

70) Let $A = \begin{bmatrix} 1 & -3 & 2 \\ -3 & 4 & -1 \\ 2 & -5 & 3 \end{bmatrix}$ and $\mathbf{b} = \begin{bmatrix} -5 \\ 2 \\ -4 \end{bmatrix}$.

Define a transformation T: $\mathbb{R}^3 \to \mathbb{R}^3$ by $T(\mathbf{x}) = A\mathbf{x}$.

If possible, find a vector $\mathbf{x}$ whose image under T is $\mathbf{b}$. Otherwise, state that $\mathbf{b}$ is not in the range of the transformation T.

A) $\begin{bmatrix} -10 \\ -5 \\ -5 \end{bmatrix}$

B) $\mathbf{b}$ is not in the range of the transformation T.

C) $\begin{bmatrix} 2 \\ 2 \\ 0 \end{bmatrix}$

D) $\begin{bmatrix} 4 \\ 0 \\ -4 \end{bmatrix}$

Answer: B

Describe geometrically the effect of the transformation T.

71) Let $A = \begin{bmatrix} 1 & 0 \\ 2 & 1 \end{bmatrix}$.

Define a transformation T by $T(\mathbf{x}) = A\mathbf{x}$.

A) Horizontal shear

B) Vertical shear

C) Projection onto x_1-axis

D) Projection onto x_2-axis

Answer: B

72) Let $A = \begin{bmatrix} 0 & 0 & 0 \\ 0 & 1 & 0 \\ 0 & 0 & 1 \end{bmatrix}$.

Define a transformation T by $T(\mathbf{x}) = A\mathbf{x}$.

A) Projection onto the x_2-axis

B) Projection onto the x_2x_3-plane

C) Vertical shear

D) Horizontal shear

Answer: B

Access Complete Test Bank for Linear Algebra and its Applications 6th Lay

Solve the problem.

73) The columns of $I_3 = \begin{bmatrix} 1 & 0 & 0 \\ 0 & 1 & 0 \\ 0 & 0 & 1 \end{bmatrix}$ are $\mathbf{e}_1 = \begin{bmatrix} 1 \\ 0 \\ 0 \end{bmatrix}$, $\mathbf{e}_2 = \begin{bmatrix} 0 \\ 1 \\ 0 \end{bmatrix}$, $\mathbf{e}_3 = \begin{bmatrix} 0 \\ 0 \\ 1 \end{bmatrix}$.

Suppose that T is a linear transformation from $\mathbb{R}^3$ into $\mathbb{R}^2$ such that

$$T(\mathbf{e}_1) = \begin{bmatrix} 3 \\ -2 \end{bmatrix}, T(\mathbf{e}_2) = \begin{bmatrix} 2 \\ 0 \end{bmatrix}, \text{ and } T(\mathbf{e}_3) = \begin{bmatrix} -4 \\ 1 \end{bmatrix}.$$

Find a formula for the image of an arbitrary $x = \begin{bmatrix} x_1 \\ x_2 \\ x_3 \end{bmatrix}$ in $\mathbb{R}^3$.

A) $T\begin{bmatrix} x_1 \\ x_2 \\ x_3 \end{bmatrix} = \begin{bmatrix} 3x_1 - 2x_2 \\ 2x_1 \end{bmatrix}$

B) $T\begin{bmatrix} x_1 \\ x_2 \\ x_3 \end{bmatrix} = \begin{bmatrix} 3x_1 + 2x_2 - 4x_3 \\ -2x_1 + x_3 \end{bmatrix}$

C) $T\begin{bmatrix} x_1 \\ x_2 \\ x_3 \end{bmatrix} = \begin{bmatrix} 3x_1 - 2x_2 \\ 2x_1 \\ 4x_2 + x_3 \end{bmatrix}$

D) $T\begin{bmatrix} x_1 \\ x_2 \\ x_3 \end{bmatrix} = \begin{bmatrix} 3x_1 + 2x_2 - 4x_3 \\ 2x_1 \\ -2x_1 + x_3 \end{bmatrix}$

Answer: B

Find the standard matrix of the linear transformation T.

74) T: $\mathbb{R}^2 \to \mathbb{R}^2$ rotates points (about the origin) through $\frac{7}{4}\pi$ radians (with counterclockwise rotation for a positive angle).

A) $\begin{bmatrix} -\frac{\sqrt{2}}{2} & -\frac{\sqrt{2}}{2} \\ -\frac{\sqrt{2}}{2} & \frac{\sqrt{2}}{2} \end{bmatrix}$

B) $\begin{bmatrix} \frac{\sqrt{3}}{3} & \frac{\sqrt{3}}{3} \\ -\frac{\sqrt{3}}{3} & \frac{\sqrt{3}}{3} \end{bmatrix}$

C) $\begin{bmatrix} 1 & 1 \\ -1 & 1 \end{bmatrix}$

D) $\begin{bmatrix} \frac{\sqrt{2}}{2} & \frac{\sqrt{2}}{2} \\ -\frac{\sqrt{2}}{2} & \frac{\sqrt{2}}{2} \end{bmatrix}$

Answer: D

75) T: $\mathbb{R}^2 \to \mathbb{R}^2$ first performs a vertical shear that maps $\mathbf{e}_1$ into $\mathbf{e}_1 + 3\mathbf{e}_2$, but leaves the vector $\mathbf{e}_2$ unchanged, then reflects the result through the horizontal x_1-axis.

A) $\begin{bmatrix} -1 & -3 \\ 0 & 1 \end{bmatrix}$

B) $\begin{bmatrix} 1 & 0 \\ -3 & -1 \end{bmatrix}$

C) $\begin{bmatrix} 1 & 3 \\ 0 & -1 \end{bmatrix}$

D) $\begin{bmatrix} -1 & 0 \\ 3 & -1 \end{bmatrix}$

Answer: B

Access Complete Test Bank for Linear Algebra and its Applications 6th Lay

Determine whether the linear transformation T is one–to–one and whether it maps as specified.

76) Let T be the linear transformation whose standard matrix is

$$A = \begin{bmatrix} 1 & -2 & 3 \\ -1 & 3 & -4 \\ -5 & 5 & -6 \end{bmatrix}.$$

Determine whether the linear transformation T is one–to–one and whether it maps $\mathbb{R}^3$ onto $\mathbb{R}^3$.

A) One–to–one; not onto $\mathbb{R}^3$

B) Not one–to–one; not onto $\mathbb{R}^3$

C) One–to–one; onto $\mathbb{R}^3$

D) Not one–to–one; onto $\mathbb{R}^3$

Answer: C

77) $T(x_1, x_2, x_3) = (-2x_2 - 2x_3, -2x_1 + 9x_2 + 5x_3, -x_1 - 2x_3, 3x_2 + 3x_3)$

Determine whether the linear transformation T is one–to–one and whether it maps $\mathbb{R}^3$ onto $\mathbb{R}^4$.

A) Not one–to–one; onto $\mathbb{R}^4$

B) Not one–to–one; not onto $\mathbb{R}^4$

C) One–to–one; not onto $\mathbb{R}^4$

D) One–to–one; onto $\mathbb{R}^4$

Answer: B

Solve the problem.

78) The table shows the amount (in g) of protein, carbohydrate, and fat supplied by one unit (100 g) of three different foods.

	Food 1	Food 2	Food 3
Protein	15	35	25
Carbohydrate	45	30	50
Fat	6	4	1

Betty would like to prepare a meal using some combination of these three foods. She would like the meal to contain 15 g of protein, 25 g of carbohydrate, and 3 g of fat. How many units of each food should she use so that the meal will contain the desired amounts of protein, carbohydrate, and fat? Round to 3 decimal places.

A) 0.326 units of Food 1, 0.247 units of Food 2, 0.059 units of Food 3

B) 0.302 units of Food 1, 0.238 units of Food 2, 0.085 units of Food 3

C) 0.280 units of Food 1, 0.192 units of Food 2, 0.164 units of Food 3

D) 0.360 units of Food 1, 0.204 units of Food 2, 0.055 units of Food 3

Answer: A

79) The population of a city in 2000 was 400,000 while the population of the suburbs of that city in 2000 was 800,000. Suppose that demographic studies show that each year about 5% of the city's population moves to the suburbs (and 95% stays in the city), while 4% of the suburban population moves to the city (and 96% remains in the suburbs).
Compute the population of the city and of the suburbs in the year 2002. For simplicity, ignore other influences on the population such as births, deaths, and migration into and out of the city/suburban region.

A) City: 412,000
Suburbs: 788,000

B) City: 361,000
Suburbs: 839,000

C) City: 361,000
Suburbs: 737,280

D) City: 422,920
Suburbs: 777,080

Answer: D

Access Complete Test Bank for Linear Algebra and its Applications 6th Lay

1) C
2) A
3) B
4) D
5) C
6) C
7) D
8) B
9) D
10) A
11) A
12) A
13) A
14) A
15) B
16) B
17) B
18) B
19) A
20) B
21) B
22) C
23) C
24) C
25) B
26) B
27) C
28) B
29) D
30) D
31) B
32) D
33) C
34) D
35) C
36) D
37) B
38) B
39) C
40) A
41) A
42) A
43) B
44) C
45) D
46) B
47) A

Access Complete Test Bank for Linear Algebra and its Applications 6th Lay

48) $500\mathbf{a} + 100\mathbf{b} = \begin{bmatrix} 290 \\ 120 \\ 60 \end{bmatrix}$

$500\mathbf{a} + 100\mathbf{b}$ lists the various costs for producing \$500 worth of product A and \$100 worth of product B, namely \$290 for materials, \$120 for labor, and \$60 for overhead.

49) $x_1\mathbf{a} + x_2\mathbf{b} = \begin{bmatrix} 205 \\ 100 \\ 50 \end{bmatrix}$

or

$$x_1\begin{bmatrix} 0.45 \\ 0.20 \\ 0.10 \end{bmatrix} + x_2\begin{bmatrix} 0.40 \\ 0.20 \\ 0.10 \end{bmatrix} = \begin{bmatrix} 205 \\ 100 \\ 50 \end{bmatrix}$$

$x_1 = 100, x_2 = 400$

50) B
51) C
52) B
53) A
54) B
55) C
56) A
57) C
58) D
59) C
60) A
61) C
62) D
63) A
64) A
65) D
66) D
67) B
68) C
69) C
70) B
71) B
72) B
73) B
74) D
75) B
76) C
77) B
78) A
79) D

Access Complete Test Bank for Linear Algebra and its Applications 6th Lay