Test Bank for Calculus Early Transcendentals 4th Rogawski

Access Complete Test Bank for Calculus Early Transcendentals 4th Rogawski

Name:_____ Class:_____ Date:_____

Chapter 02

1. The potential energy V of a pendulum of length 1 and mass 2, relative to its rest position is $V = 2g(1 - \cos\theta)$. Compute the average rate of change of the potential energy over the angle interval $\left[\frac{\pi}{4}, \frac{\pi}{3}\right]$.

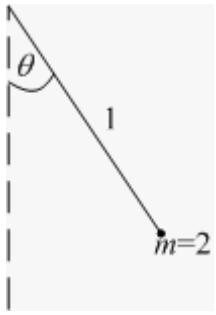

ANSWER: $\frac{12g\left(\sqrt{2}-1\right)}{\pi} \approx 1.58g$

2. Let $S(x)$ denote the slope of the line segment connecting the origin to the point (x, y) on the graph of the equation $y = x^3 + 1$. Calculate the average rate of change of $S(x)$ for $1 \le x \le 2$.

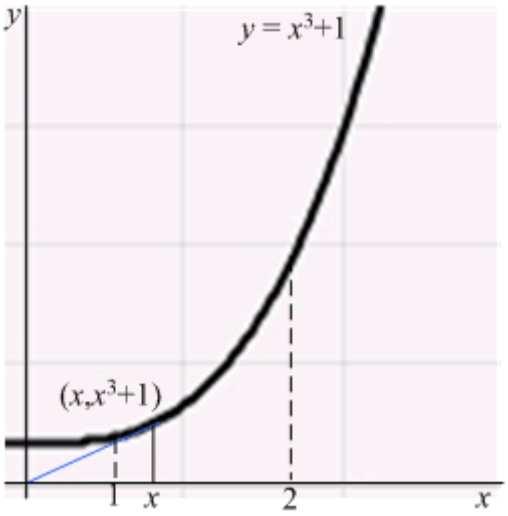

ANSWER: $2\frac{1}{2}$

3. The flight time of a shell shot at an angle θ and initial velocity V is $T_f = \frac{2V}{g}\sin\theta$. Compute the average rate of change of the flight time for θ in the interval $\left[\frac{\pi}{6}, \frac{\pi}{4}\right]$.

ANSWER: $\frac{12\left(\sqrt{2}-1\right)V}{\pi g}$

4. Let $S(x)$ denote the slope of the line segment connecting the origin to the point (x, y) on the graph of the

Copyright Macmillan Learning. Powered by Cognero.

Access Complete Test Bank for Calculus Early Transcendentals 4th Rogawski

Chapter 02

equation $y = \sqrt{x-1}$. Calculate the average rate of change of $S(x)$ for $2 \le x \le 5$.

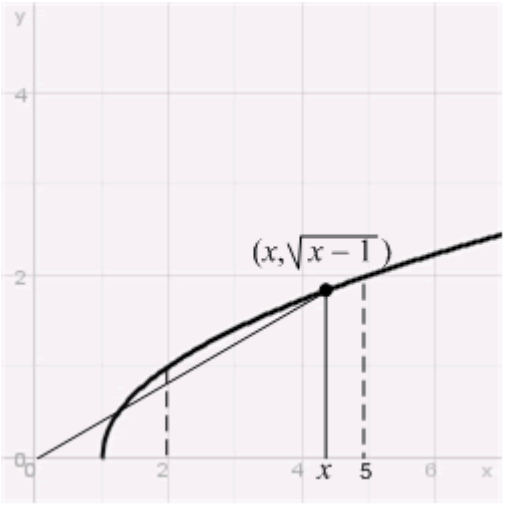

ANSWER: $-\frac{1}{30}$

5. The volume of a cone of radius R and height H is $V = \frac{\pi R^2 H}{3}$.

What is the average rate of change of V if the radius increases from 1 to 3 and the height remains unchanged?
ANSWER: $\frac{4\pi H}{3}$

6. The electrical field due to an infinite rod at a point at distance r from the rod is perpendicular to the rod and has a magnitude of $E(r) = \frac{1}{2\pi\varepsilon_0} \cdot \frac{\lambda}{r}$ (ε_0 is a constant and λ is the longitudinal charge density).

Find the average rate of change of the field along the interval $2 \le r \le 4$.



ANSWER: $-\frac{\lambda}{16\pi\varepsilon_0}$

7. Let $S(x)$ denote the slope of the line segment connecting the origin to the point (x, y) on the graph of the semi-ellipse $y = 2\sqrt{1 - \frac{x^2}{9}}$. Calculate the average rate of change of $S(x)$ for $2 \le x \le 2.5$

Copyright Macmillan Learning. Powered by Cognero.

Access Complete Test Bank for Calculus Early Transcendentals 4th Rogawski

Chapter 02

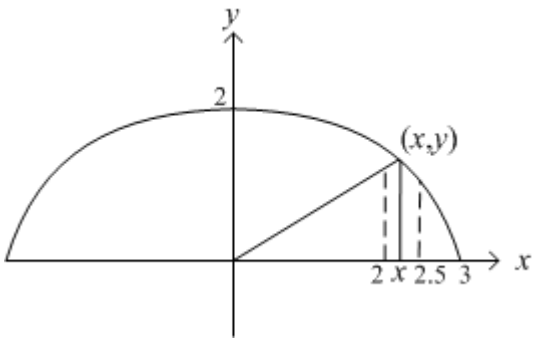

ANSWER: -0.206 per unit length

8. The electrical field caused by an electrical charge q at a point at distance r is $E = \frac{kq}{r^2}$ (k is a constant). Find the average rate of change of the field along the interval $1 \le r \le 3$.

ANSWER: $-\frac{4kq}{9}$

9. The volume of a sphere of radius R is $V = \frac{4\pi R^3}{3}$. What is the average rate of change of the volume when the radius increases from $R = 1$ to $R = 3$?

ANSWER: $\frac{52\pi}{3}$

10. Let $S(x)$ denote the slope of the line segment connecting the origin to the point (x, y) on the graph of the equation $y = \sqrt{x-1}$. Calculate the average rate of change of $S(x)$ for $5 \le x \le 10$.

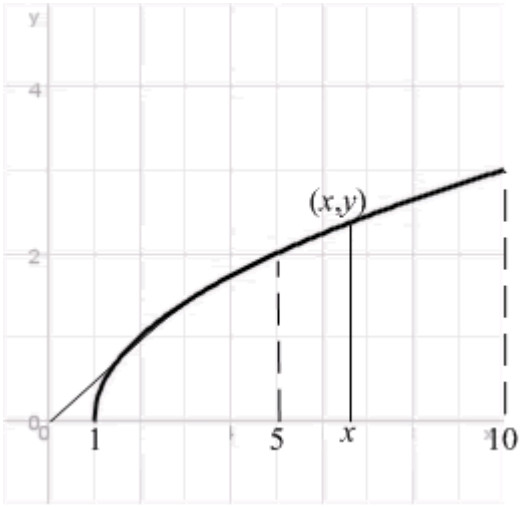

ANSWER: $-\frac{1}{50}$

11. The position of a particle is given by $g(t) = 2t^2 + 5$. Compute the average velocity over the time interval

Copyright Macmillan Learning. Powered by Cognero.

Access Complete Test Bank for Calculus Early Transcendentals 4th Rogawski

Chapter 02

$[4, 6]$. Estimate the instantaneous velocity at $t = 4$.

ANSWER: Average velocity over $[4, 6]$: 20
Instantaneous velocity at $t = 4$: 16

12. A balloon is blown up and takes the shape of a sphere. What is the average rate of change of the surface area of the balloon as the radius increases from 3 to 4 cm?

ANSWER: 28π

13. Determine $\lim_{x \to 1+} f(x)$ and $\lim_{x \to 1-} f(x)$ for the function shown in the figure.

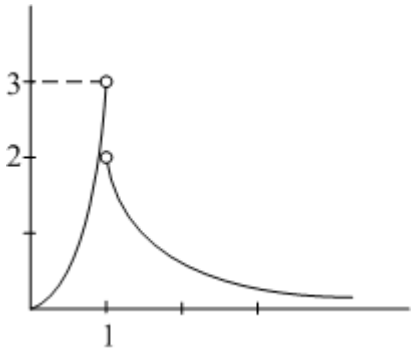

ANSWER: $\lim_{x \to 1+} f(x) = 2$ $\lim_{x \to 1-} f(x) = 3$

14. The greatest integer function is defined by $[x] = n$, where n is the unique integer such that $n \le x < n + 1$.
The graph of $f(x) = x - [x]$ is shown in the figure.

A) For which values of c does $\lim_{x \to c-} f(x)$ exist?

B) For which values of c does $\lim_{x \to c+} f(x)$ exist?

C) For which values of c does $\lim_{x \to c} f(x)$ exist?

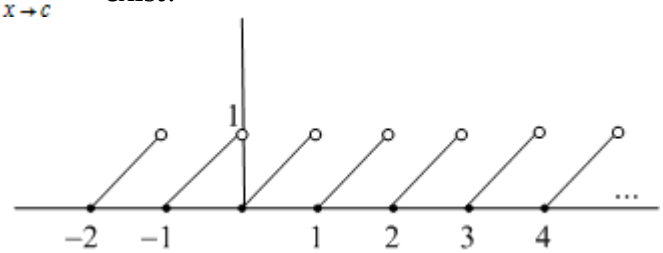

ANSWER: A) All c
B) All c
C) Every real number c that is not an integer

15. The graph of a function $y = f(x)$ is shown in the figure.
Determine the following limits or state that the limit does not exist (if the limit is infinite, write ∞ or $-\infty$):

Copyright Macmillan Learning. Powered by Cognero.

Access Complete Test Bank for Calculus Early Transcendentals 4th Rogawski

Name:_____ Class:_____ Date:_____

Chapter 02

A) $\lim_{x \to 0+} f(x)$ B) $\lim_{x \to 5-} f(x)$ C) $\lim_{x \to 5+} f(x)$ D) $\lim_{x \to 5} f(x)$ E) $\lim_{x \to 6-} f(x)$
F) $\lim_{x \to 6+} f(x)$ G) $\lim_{x \to 6} f(x)$ H) $\lim_{x \to 7-} f(x)$ I) $\lim_{x \to 7+} f(x)$ J) $\lim_{x \to 7} f(x)$

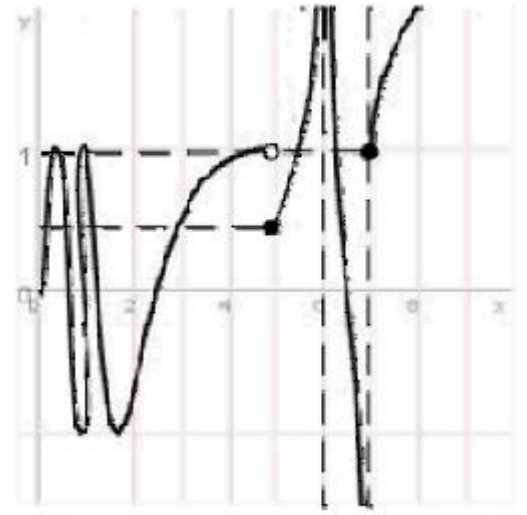

ANSWER: A)0 B)1 C)$\frac{1}{2}$ D)Does not exist E)∞
F)∞ G)∞ H)$-\infty$ I)1 J)Does not exist

16. Determine the one-sided limits at $c = 1, 3, 5$ of the function $f(x)$ shown in the figure and state whether the limit exists at these points.

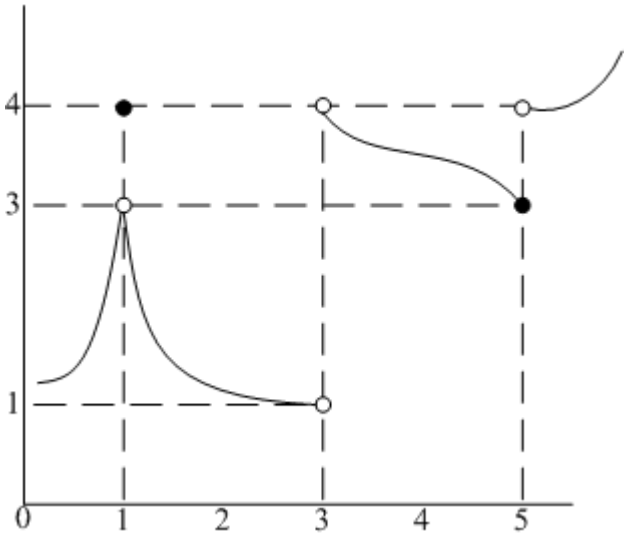

ANSWER: $\lim_{x \to 1-} f(x) = \lim_{x \to 1+} f(x) = 3$; limit exists
$\lim_{x \to 3-} f(x) = 1$, $\lim_{x \to 3+} f(x) = 4$; limit does not exist
$\lim_{x \to 5-} f(x) = 3$, $\lim_{x \to 5+} f(x) = 4$; limit does not exist

Copyright Macmillan Learning. Powered by Cognero.

Access Complete Test Bank for Calculus Early Transcendentals 4th Rogawski

Chapter 02

17. Consider the function $f(x) = \dfrac{[x]}{x}$ for $x > 0$. (Here, [x] denotes the greatest integer function.)

A) Write $f(x)$ in piecewise form.
What is $f(n)$ for positive integers n?

B) Determine $\lim\limits_{x \to 3-} f(x)$ and $\lim\limits_{x \to 3+} f(x)$.

C) For which values of c does $\lim\limits_{x \to c} f(x)$ exist?

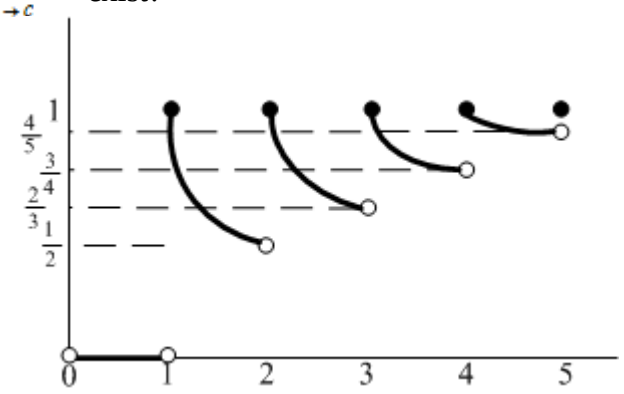

ANSWER:

A) $$f(x) = \begin{cases} 0 & 0 < x < 1 \\ \dfrac{n}{x} & n \le x < n+1 \quad n = 1, 2, \ldots \end{cases}$$

$f(n) = 1 \quad n = 1, 2, \ldots$

B) $\dfrac{2}{3}, 1$

C) The limit exists for all positive real numbers that are not integers.

18. Determine the one-sided limits at $c = 1, 2, 3, 4$ of the function shown in the figure and state whether the limit exists at these points.

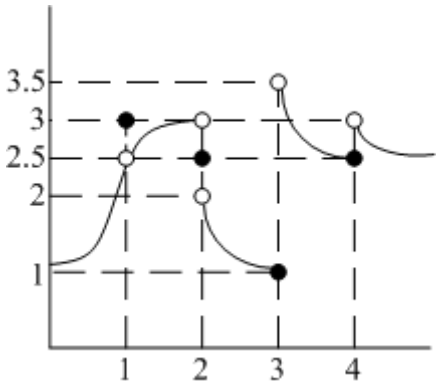

ANSWER:

c	Left-sided	Right-sided	Limit
1	2.5	2.5	Exists (2.5)
2	3	2	Does not exist
3	1	3.5	Does not exist
4	2.5	3	Does not exist

Copyright Macmillan Learning. Powered by Cognero.

Access Complete Test Bank for Calculus Early Transcendentals 4th Rogawski

Name:_____ Class:_____ Date:_____

Chapter 02

19. Consider the function $f(x) = x + 1 - [x]$ for $x \geq 1$. (Here, [*x*] denotes the greatest integer function.)
A) Write f in piecewise form. What is $f(n)$ for positive integers $n \geq 1$?
B) Find $\lim_{x \to 2-} f(x)$ and $\lim_{x \to 2+} f(x)$.
C) For which values of c does the limit $\lim_{x \to c} f(x)$ fail to exist?

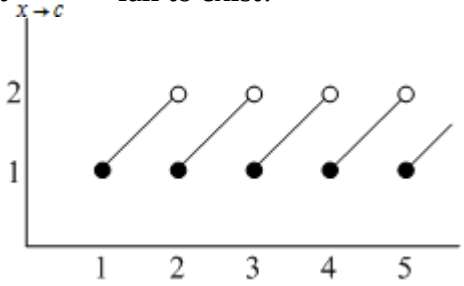

ANSWER: A) $f(x) = x + 1 - n$ for $n \leq x < n + 1$, $f(n) = 1$
B) $2, 1$
C) The limit fails to exist for all positive integers.

20. Determine the one-sided limits at $c = 1, 2, 3, 4$ of the function shown in the figure and state whether the limit exists at these points.

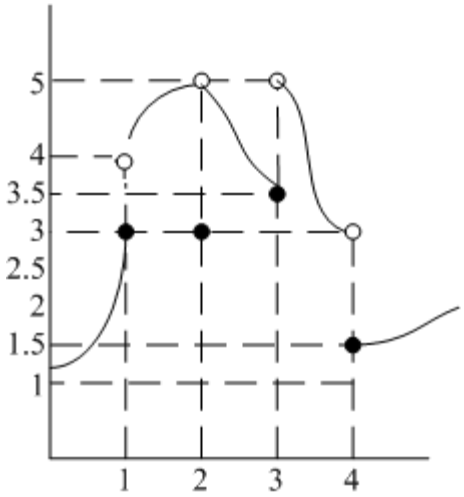

ANSWER:

c	Left-sided	Right-sided	Limit
1	3	4	Does not exist
2	5	5	Exists (5)
3	3.5	5	Does not exist
4	3	1.5	Does not exist

21. Let $f(x)$ be the following function defined for $-0.5 \leq x \leq 4.5$:

Copyright Macmillan Learning. Powered by Cognero.

Access Complete Test Bank for Calculus Early Transcendentals 4th Rogawski

Name:_____ Class:_____ Date:_____

Chapter 02

$$f(x)=\begin{cases}1, \text{ if } \sin\left(\frac{\pi x}{2}\right)>0\\ -1, \text{ if } \sin\left(\frac{\pi x}{2}\right)<0\\ 0, \text{ if } \sin\left(\frac{\pi x}{2}\right)=0\end{cases}$$

Write $f(x)$ as a piecewise-defined function where the intervals are in terms of *x* instead of $\sin\left(\frac{\pi x}{2}\right)$, sketch its graph, and determine the points where the limit of $f(x)$ does not exist. Find the one-sided limits at these points.

ANSWER:

$$f(x)=\begin{cases}-1 & -0.5\le x<0\\ 0 & x=0\\ 1 & 0<x<2\\ 0 & x=2\\ -1 & 2<x<4\\ 0 & x=4\\ 1 & 4<x\le 4.5\end{cases}$$

$x=-0.5,\ 0,\ 2,\ 4,\ 4.5$

$\lim\limits_{x\to -0.5+} f(x)=-1$ $\lim\limits_{x\to 0-} f(x)=-1$ $\lim\limits_{x\to 0+} f(x)=1$ $\lim\limits_{x\to 2-} f(x)=1$

$\lim\limits_{x\to 2+} f(x)=-1$ $\lim\limits_{x\to 4-} f(x)=-1$ $\lim\limits_{x\to 4+} f(x)=1$ $\lim\limits_{x\to 4.5-} f(x)=1$

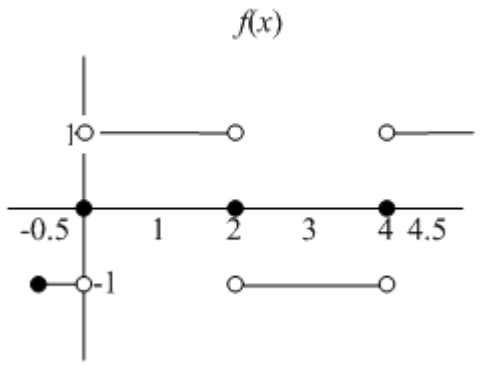

22. Find a real number c such that $\lim\limits_{x\to 1} f(x)$ exists and compute the limit.

$$f(x)=\begin{cases}x-\dfrac{3}{x-2} & x<1\\ 10 & x=1\\ \dfrac{c}{(x+1)^2} & x>1\end{cases}$$

Copyright Macmillan Learning. Powered by Cognero.

Access Complete Test Bank for Calculus Early Transcendentals 4th Rogawski

Chapter 02

ANSWER: $c = 16; \lim_{x \to 1} f(x) = 4$

23. Let $\lim_{x \to a} f(x) = L$. Determine whether each of the following statements is always true, never true, or sometimes true.

A) $\lim_{x \to a-} f(x) = L$

B) $4f(a) = 3L$

C) $\lim_{x \to a-} f(x) - \lim_{x \to a+} f(x) < 0$

D) $\frac{\lim_{x \to a-} f(x)}{\lim_{x \to a+} f(x)} = 1$

ANSWER: A) Always
B) Sometimes
C) Never
D) Sometimes (note the case when $\lim_{x \to a} f(x) = 0$)

24. Compute the following one-sided limits:

A) $\lim_{x \to 2-} \frac{\sqrt{2-x}}{x^2+5x}$

B) $\lim_{\theta \to 0+} \frac{\theta^3 \cos^2 \theta}{\sin \theta}$

C) $\lim_{\theta \to \frac{\pi}{2}+} \frac{\theta^3}{\tan \theta}$

ANSWER: A) 0
B) 0
C) 0

25. Evaluate the limits using the Limit Laws:

A) $\lim_{x \to -1} \left(x^3 - 2x^2 + 1\right)$

B) $\lim_{t \to 1} \frac{t^2 - t}{t+1}$

C) $\lim_{x \to 0} \frac{1 + \cos x}{x^3 + 2}$

D) $\lim_{t \to 0} \frac{3 \sin t}{2t}$

ANSWER: A) -2
B) 0

Copyright Macmillan Learning. Powered by Cognero.

Access Complete Test Bank for Calculus Early Transcendentals 4th Rogawski

Chapter 02

C) 1

D) $\frac{3}{2}$

26. Which of the following functions are examples of the existence of the limit $\lim_{x \to 0} \frac{f(x)}{g(x)}$, although the limits of $f(x)$ and $g(x)$ as $x \to 0$ do not exist?

a. $f(x) = x \;\; g(x) = \frac{1}{x}$

b. $f(x) = \frac{\sin x}{x} \;\; g(x) = \frac{1}{x}$

c. $f(x) = \frac{1}{x} \;\; g(x) = \frac{1}{x^3}$

d. $f(x) = x^2 \;\; g(x) = \cos x$

e. $f(x) = \frac{x}{\sin x} \;\; g(x) = \frac{1}{x}$

ANSWER: c

27. Let $f(x)$, $g(x)$ be functions and let $F(x) = f(x) - g(x)$. Consider the following statement: If $\lim_{x \to x_0} F(x)$ and $\lim_{x \to x_0} g(x)$ exist, then $\lim_{x \to x_0} f(x)$ also exists. To prove this statement, we should use which of the following?

a. The statement is not true.

b. The Product Rule applied to $\frac{F+g}{g}$ and g.

c. The Quotient Rule applied to $(F+g)g$ and g.

d. The Sum Rule applied to F and g.

ANSWER: d

28. Evaluate the limits using the Limit Laws:

A) $\lim_{t \to (-2)} (2t+1)(t^2+2)$

B) $\lim_{x \to (-1)} \frac{x^2+3x}{x-1}$

C) $\lim_{x \to \frac{\pi}{4}} \frac{\sin x + \cos x}{2 \tan x}$

Copyright Macmillan Learning. Powered by Cognero.

Access Complete Test Bank for Calculus Early Transcendentals 4th Rogawski

Chapter 02

D) $\lim_{x \to 4} \dfrac{2x^{-1} + x^{-\frac{1}{2}}}{x+3}$

ANSWER: A) -18
B) 1
C) $\dfrac{\sqrt{2}}{2}$
D) $\dfrac{1}{7}$

29. Determine whether the following statement is correct: If $\lim_{x \to 0} xg(x) = 0$, then $\lim_{x \to 0} g(x)$ exists. If yes, prove it; otherwise, give a counter example

ANSWER: False; $g(x) = \begin{cases} 1 & x \geq 0 \\ -1 & x < 0 \end{cases}$

30. Evaluate the limits using the Limit Laws:

A) $\lim_{t \to 3} \left(t^2 + t - 1\right) \sin \dfrac{\pi t}{2}$

B) $\lim_{x \to -1} \dfrac{x^3 + 5}{x^2 + 2x - 1}$

C) $\lim_{y \to 4} \dfrac{y^{-\frac{1}{2}} \tan\left(\frac{\pi y}{16}\right)}{\sqrt{y^2 + 9}}$

ANSWER: A) -11
B) -2
C) $\dfrac{1}{10}$

31. A) Can the Product Rule be used to compute the limit $\lim_{x \to 0} [x]x$? (Here, $[x]$ denotes the greatest integer function.) Explain.

B) Show that $\lim_{x \to 0} [x]x$ exists and find it. *Hint:* Compute the one-sided limits.

ANSWER: A) No. The limit $\lim_{x \to 0} [x]$ does not exist.
B) 0

32. Let $f(x)$, $g(x)$, and $F(x) = f(x) + g(x)$. To prove that if $\lim_{x \to x_0} f(x)$ and $\lim_{x \to x_0} F(x)$ exist then also $\lim_{x \to x_0} g(x)$ exists, we should use which of the following?

Copyright Macmillan Learning. Powered by Cognero.

Access Complete Test Bank for Calculus Early Transcendentals 4th Rogawski

Chapter 02

a. The Product Rule applied to $\frac{F-f}{f}$ and f.

b. The Quotient Rule applied to $(F-f)f$ and f.

c. The Sum Rule applied to F and $-f$.

d. The statement is not true.

e. Both A and C

ANSWER: c

33. Evaluate the limits using the Limit Laws:

A) $\lim_{x \to -1} \frac{x+2}{x^3-x-1}$

B) $\lim_{x \to 1} \left(x^2-x^{-3}+x\right)(x+1)$

C) $\lim_{x \to \frac{\pi}{4}} \frac{\sin x+\cos x}{x}$

ANSWER: A) -1

B) 2

C) $\frac{4\sqrt{2}}{\pi}$

34. Consider this statement: If $\lim_{x \to x_0} f(x) = c \neq 0$ and $\lim_{x \to x_0} g(x) = 0$, then $\frac{f(x)}{g(x)}$ does not converge to a finite limit as $x \to x_0$.

To prove this statement, we assume that $\lim_{x \to x_0} \frac{f(x)}{g(x)} = M$ exists and is finite. Then, by the Quotient Rule, $\lim_{x \to x_0} \frac{g(x)}{f(x)} = 0$ and by the Product Rule, $\lim_{x \to x_0} \left[\frac{f(x)}{g(x)} \cdot \frac{g(x)}{f(x)}\right] = 0$.

Which of the following statements completes the proof?

a. From $\lim_{x \to x_0} \left[\frac{f(x)}{g(x)} \cdot \frac{g(x)}{f(x)}\right] = 0$, it follows that 1 = 0, which is a contradiction.

b. From $\lim_{x \to x_0} \frac{g(x)}{f(x)} = 0$, we can conclude that $\lim_{x \to x_0} \frac{f(x)}{g(x)} = 0$, which contradicts our assumption.

c. From $\lim_{x \to x_0} \frac{g(x)}{f(x)} = 0$, we can conclude that $\lim_{x \to x_0} \frac{f(x)}{g(x)} = \infty$, which contradicts our assumption.

d. From $\lim_{x \to x_0} \left[\frac{f(x)}{g(x)} \cdot \frac{g(x)}{f(x)}\right] = 0$, we can conclude that $\lim_{x \to x_0} \frac{f(x)}{g(x)} = 1$, which contradicts our assumption.

ANSWER: a

Copyright Macmillan Learning. Powered by Cognero.

Access Complete Test Bank for Calculus Early Transcendentals 4th Rogawski

Chapter 02

35. Which of the following functions are examples of the existence of the limit $\lim_{x\to 0}\frac{f(x)}{g(x)}$, although the limits $\lim_{x\to 0} f(x)$ and $\lim_{x\to 0} g(x)$ do not exist?

a. $f(x)=\frac{1}{x}, g(x)=x^2$

b. $f(x)=\frac{1}{x}, g(x)=\frac{1}{\sin x}$

c. $f(x)=[x], g(x)=x$ (Here, [*x*] denotes the greatest integer function.)

d. $f(x)=\frac{1}{x^2}, g(x)=\frac{1}{x}$

e. $f(x)=\frac{1}{1-x}, g(x)=\frac{1}{1-\sin x}$

ANSWER: b

36. Assume a and L are nonzero real numbers. If $\lim_{x\to a} 2f(x)=L$ and $\lim_{x\to a}\frac{g(x)}{4}=0$, calculate the following limits, if possible. If not, state that it is not possible.

A) $\lim_{x\to a} f(x)\cdot g(x)$

B) $\lim_{x\to a}\frac{f(x)}{g(x)}$

C) $\lim_{x\to a}\frac{f(x)+x^2}{g(x)+a}$

ANSWER: A) 0

B) Not possible

C) $\frac{\frac{L}{2}+a^2}{a}$

37. Determine the points at which the following functions are not continuous and state the type of discontinuity: removable, jump, infinite, or none of these.

A) $f(x)=\frac{x^2-1}{|x-3|}$

B) $g(x)=\frac{\sin x}{x}$

C) $h(x)=x-[x]$ (Here, [*x*] denotes the greatest integer function.)

D) $j(x)=\left|\sin\frac{1}{x}\right|$

Copyright Macmillan Learning. Powered by Cognero.

Access Complete Test Bank for Calculus Early Transcendentals 4th Rogawski

Chapter 02

E) $k(x) = \dfrac{3x^2 - 27}{3 + x}$

ANSWER: A) $x = 3$; infinite
B) $x = 0$; removable
C) Integers; jump
D) $x = 0$; none of these
E) $x = -3$; removable

38. At each point of discontinuity, state whether the function is left or right continuous:

A) $f(x) = \begin{cases} \sin\left(\dfrac{\pi x}{2}\right) + 4 & |x| \le 2 \\ |x - 2| & |x| > 2 \end{cases}$

B) $f(x) = \begin{cases} 1 & x \le 0 \\ \dfrac{\sin x}{x} & 0 < x \le \dfrac{\pi}{2} \\ \dfrac{2x}{\pi - x} & \dfrac{\pi}{2} < x < \pi \\ x - \pi & \pi \le x \end{cases}$

ANSWER: A) $x = 2$; left continuous
B) $x = \dfrac{\pi}{2}$; left continuous
$x = \pi$; right continuous

39. Determine real numbers *a*, *b*, and c that make the function continuous:

$$f(t) = \begin{cases} a & t < 0 \\ \dfrac{1}{4}t(t + 8) & 0 \le t < b \\ t + 3 & b \le t < 4 \\ c & 4 \le t \end{cases}$$

ANSWER: $a = 0, b = 2, c = 7$

40. Find the points of discontinuity for each of these functions and state the type of discontinuity: removable, jump, infinite, or none of these.

A) $f(x) = \dfrac{|4 + x|}{4 + x}$

B) $g(x) = \dfrac{[x]}{x}, \quad x > 0$ (Here, $[x]$ denotes the greatest integer function.)

Copyright Macmillan Learning. Powered by Cognero.

Access Complete Test Bank for Calculus Early Transcendentals 4th Rogawski

Chapter 02

C) $h(x) = \dfrac{1-x}{x^2+4x-5}$

ANSWER: A) $x = -4$; jump
B) x = positive integer; jump
C) $x = 1$ removable; $x = -5$ infinite

41. Determine whether the function is left or right continuous at each of its points of discontinuity:

A) $f(x) = \begin{cases} \cos \pi x & |x| \le \dfrac{1}{2} \\ x - \dfrac{1}{2} & |x| > \dfrac{1}{2} \end{cases}$

B) $f(x) = x^2[x], x \ge 0$ (Here, $[x]$ denotes the greatest integer function.)

ANSWER: A) $x = -\dfrac{1}{2}$ right continuous

B) Right continuous at the positive integers

42. Determine real numbers $a, b,$ and c that make the following function continuous:

$$f(t) = \begin{cases} t+a & t<0 \\ t^2+t+b+\dfrac{a}{2} & 0 \le t < 1 \\ t-b & 1 \le t < 2 \\ c & 2 \le t \end{cases}$$

ANSWER: $a = -\dfrac{2}{3}, b = -\dfrac{1}{3}, c = \dfrac{7}{3}$

43. Determine the points where the function is not continuous and state the type of the discontinuity: removable, jump, infinite, or none of these.

A) $f(x) = \dfrac{x^2+2x-8}{|x-2|}$

B) $g(x) = \dfrac{x}{[x]}, x \ge 1$ (Here, $[x]$ denotes the greatest integer function.)

C) $h(x) = \dfrac{(x^3-3x+2)\sin 2x}{x}$

D) $j(x) = \dfrac{4}{|x|-3}$

ANSWER: A) $x = 2$, jump
B) $x = 2, 3, 4, \ldots$; jump
C) $x = 0$; removable
D) $x = 3$, $x = -3$; infinite

Copyright Macmillan Learning. Powered by Cognero.

Access Complete Test Bank for Calculus Early Transcendentals 4th Rogawski

Chapter 02

44. At each point of discontinuity, state whether the function is left or right continuous.

A) $f(x)=\begin{cases}\sin\dfrac{1}{x} & x<0\\ 1+x^2 & 0\le x<2\\ (x+1)^2-4 & 2\le x<3\\ 10 & 3\le x\end{cases}$

B) $f(x)=\begin{cases}|x-1| & x\le 2\\ x^2-3 & 2<x\le 4\\ \dfrac{1}{x-4} & 4<x<5\\ 6 & 5\le x\end{cases}$

ANSWER: A) $x=0$; right continuous
$x=3$; right continuous
B) $x=4$; left continuous
$x=5$; right continuous

45. Determine real numbers a, b, and c that make the following function continuous:

$$f(x)=\begin{cases}a & x\le -1\\ \dfrac{x}{[x]} & -1<x<0\\ \dfrac{\sin\left(\frac{\pi x}{2}\right)+b+c}{x^2+1} & 0\le x<1\\ b & 1\le x\end{cases}$$

(Here, [x] denotes the greatest integer function.)

ANSWER: $a=1;\ b=\dfrac{1}{2};\ c=-\dfrac{1}{2}$

46. Determine the points where the function is not continuous and state the type of discontinuity: removable, jump, infinite, or none of these:

A) $f(x)=\dfrac{x^2+x-6}{x-2}$

B) $g(x)=\dfrac{1}{x-2}+\sin\dfrac{1}{x}$

C) $h(x)=[x]x$ (Here, [x] denotes the greatest integer function.)

D) $j(x)=\dfrac{x^2+x-6}{x-3}$

ANSWER: A) $x=2$; removable
B) $x=2$; infinite

Copyright Macmillan Learning. Powered by Cognero.

Access Complete Test Bank for Calculus Early Transcendentals 4th Rogawski

Chapter 02

$x = 0$; none of these
C) Nonzero integers; jump
D) $x = 3$; infinite

47. At each point of discontinuity state whether the function is left continuous, right continuous, or neither

A) $f(x) = \begin{cases} \dfrac{1}{x-2} & x < 1 \\ \cos \pi x & 1 \le x \le 2 \\ \dfrac{1+x}{(x-3)^2} & 2 < x \end{cases}$

B) $f(x) = \begin{cases} 0 & x < 0 \\ \cos \pi x & 0 \le x \le 1 \\ 2 \cos \pi x & 1 < x \le 2 \\ 2 & 2 < x \end{cases}$

ANSWER: A) $x = 2$; left continuous
$x = 3$; none of these
B) $x = 0$; right continuous
$x = 1$; left continuous

48. Determine real numbers a, b, and c that make the function continuous:

$$f(x) = \begin{cases} a & t < 0 \\ x^2 + 1 & 0 \le t < b \\ 5x - c & b \le t < 7 \\ 42 & 7 \le t \end{cases}$$

ANSWER: $a = 1;\ b = 6;\ c = -7$

49. Consider the function

$$f(x) = \begin{cases} -1 & x \le 0 \\ 1 & x > 0 \end{cases}$$

The function $f(x) + g(x)$ is continuous for which of the following functions *g*?

a. $g(x) = 2$ if $x \neq 0,\ g(0) = 0$
b. $g(x) = 0$ if $x \neq 0,\ g(0) = 2$
c. $g(x) = 2$ if $x \le 0,\ g(x) = 0$ if $x > 0$
d. $g(x) = 2$ if $x < 0,\ g(x) = 0$ if $x \ge 0$
e. A and C both correct

ANSWER: c

50. Let $f(x)$ be a discontinuous function. Is it possible to find a continuous function $g(x)$ such that $f(x) + g(x)$ is continuous? Explain.

Copyright Macmillan Learning. Powered by Cognero.

Access Complete Test Bank for Calculus Early Transcendentals 4th Rogawski

Chapter 02

ANSWER: No. If $F(x) = f(x) + g(x)$ is continuous, then $f(x) = F(x) - g(x)$ is continuous by the continuity laws.

51. Sketch the graph of a function $f(x)$ that satisfies all of the following conditions:

$\lim_{x \to 2^-} f(x) = \infty$, $\lim_{x \to 2^+} f(x) = 4$, $\lim_{x \to 0} f(x) = -2$,

$\lim_{x \to \infty} f(x) = -1$, $\lim_{x \to -\infty} f(x) = 3$

ANSWER:

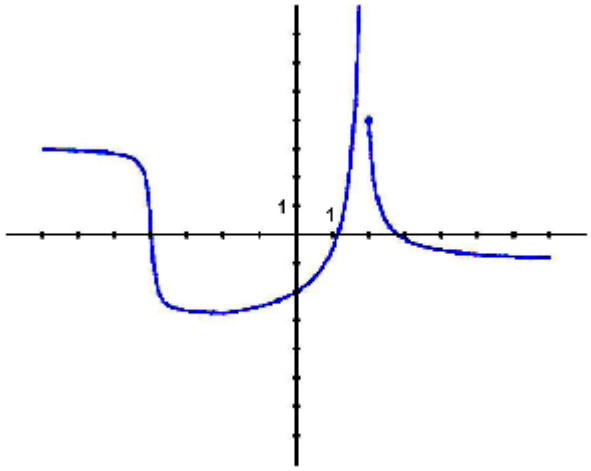

52. Evaluate each limit or state that it does not exist:

A) $\lim_{x \to 3} \dfrac{x^4 - 3x^3 + x^2 - 9}{x - 3}$

B) $\lim_{x \to 1} \dfrac{x - 1}{\sqrt{x^2 + 3x - 1} - \sqrt{2x + 1}}$

C) $\lim_{x \to 1} \dfrac{\sqrt{x^2 - 2x + 1}}{x - 1}$

ANSWER: A) 33

B) $\dfrac{2\sqrt{3}}{3}$

C) Does not exist

53. Evaluate each limit or state that it does not exist:

A) $\lim_{x \to \frac{\pi}{2}} \dfrac{\cos^2 x}{(1 + \cos 2x)(2 + \cos 2x)}$

B) $\lim_{x \to 0} \left(\dfrac{1}{x^2} - \dfrac{\sqrt{1 + x^2}}{x^2} \right)$

C) $\lim_{\theta \to 0} \dfrac{1 + \sin \theta - \cos \theta}{\sin \theta}$

Copyright Macmillan Learning. Powered by Cognero.

Access Complete Test Bank for Calculus Early Transcendentals 4th Rogawski

Chapter 02

ANSWER: A) $\frac{1}{2}$

B) $-\frac{1}{2}$

C) 1

54. Evaluate the limits in terms of the constants involved:

A) $\lim\limits_{x \to 0} \frac{\sqrt{(x+h)^2+1} - \sqrt{h^2+1}}{x}$

B) $\lim\limits_{h \to a} \frac{\frac{1}{\sqrt{a}} - \frac{1}{\sqrt{h}}}{h-a}, a > 0$

ANSWER: A) $\frac{h}{\sqrt{1+h^2}}$

B) $\frac{1}{2a\sqrt{a}}$

55. Evaluate each limit or state that it does not exist:

A) $\lim\limits_{x \to 2} \frac{x^4 - x^2 - 12}{x-2}$

B) $\lim\limits_{x \to 1} \frac{\sqrt{x^2+1} - \sqrt{x+1}}{x^2+x-2}$

C) $\lim\limits_{x \to 2} \frac{\sqrt{x^2-4x+4}}{x-2}$

ANSWER: A) 28

B) $\frac{\sqrt{2}}{12}$

C) Does not exist

56. Evaluate the limit:

$\lim\limits_{x \to 1} \frac{\sqrt{x+\sqrt{x}} - \sqrt{x+1}}{\sqrt{x}-1}$

ANSWER: $\frac{\sqrt{2}}{4}$

57. Evaluate each limit or state that it does not exist:

Copyright Macmillan Learning. Powered by Cognero.

Access Complete Test Bank for Calculus Early Transcendentals 4th Rogawski

Chapter 02

A) $\lim_{x \to 2} \dfrac{x^3 - 2x^2 + 3x - 6}{x - 2}$

B) $\lim_{x \to -1} \dfrac{\sqrt{3x+4} + x}{x^2 - x - 2}$

C) $\lim_{x \to 1} \dfrac{|x^2 + x - 2|}{x - 1}$

ANSWER: A) 7

B) $-\dfrac{5}{6}$

C) Does not exist

58. Determine a real number c for which the limit exists and then compute the limit:

$\lim_{x \to 0+} \left(\dfrac{1}{\sqrt{x + c^2}} - \dfrac{1}{\sqrt{x^2 + x}} \right)$

ANSWER: $c = 0$, the limit is 0

59. Evaluate each limit or state that it does not exist:

A) $\lim_{x \to 2} \left(\dfrac{x+1}{x-2} - \dfrac{x-5}{x^2 - 5x + 6} \right)$

B) $\lim_{x \to 5} \dfrac{\sqrt{x^2 - 6} - \sqrt{4x - 1}}{x - 5}$

C) $\lim_{x \to 8} \dfrac{\sqrt{x+1} - 3}{x - 8}$

ANSWER: A) (-1)

B) $\dfrac{3\sqrt{19}}{19}$

C) $\dfrac{1}{6}$

60. Determine a real number a for which the limit exists and then compute the limit:

$\lim_{x \to 2} \dfrac{x^2 + ax + 6}{\sqrt{x^2 + 2x - 4} - \sqrt{x + 2}}$

ANSWER: $a = -5$; limit is $-\dfrac{4}{5}$

61. Let $f(x) = 2x + 3$. Compute $\lim_{h \to 0} \dfrac{f(-3+h) - f(-3)}{h}$.

ANSWER: 2

Copyright Macmillan Learning. Powered by Cognero.

Access Complete Test Bank for Calculus Early Transcendentals 4th Rogawski

Chapter 02

62. Compute $\lim_{\theta \to 0} \left(\cot^2 \theta - \csc^2 \theta\right)$.

ANSWER: -1

63. Compute $\lim_{\theta \to \frac{7\pi}{6}} \frac{2 \sin^2 \theta - 5 \sin \theta - 3}{2 \sin \theta + 1}$.

ANSWER: $-\frac{7}{2}$

64. Evaluate the limits:

A) $\lim_{x \to 0} \frac{\sin^2 x}{\sin x^2}$

B) $\lim_{x \to 0} x \cos \frac{1}{x^3}$

C) $\lim_{x \to 0} |\sin x| \left(1 - \cos \frac{1}{x}\right)$

ANSWER: A) 1
B) 0
C) 0

65. Show that $0 \le x - [x] < 1$ for all x. (Here, [*x*] denotes the greatest integer function.)

Then use the above inequality and the Squeeze Theorem to evaluate $\lim_{x \to 0} x(x - [x])$.

ANSWER: 0

66. Evaluate the limits in terms of the constants involved:

A) $\lim_{x \to h} \frac{\sin (x - h)}{x^2 + (1 - h)x - h}$

B) $\lim_{x \to a} \frac{\frac{1}{x^2} - \frac{1}{a^2}}{x - a}$

ANSWER: A) $\frac{1}{h + 1}$

B) $\left(-\frac{2}{a^3}\right)$

67. Evaluate the limits using the Squeeze Theorem, trigonometric identities, and trigonometric limits, as necessary:

Copyright Macmillan Learning. Powered by Cognero.

Access Complete Test Bank for Calculus Early Transcendentals 4th Rogawski

Chapter 02

A) $\lim_{x \to 0} \dfrac{\sin \frac{1}{x} \sin^2 \frac{x}{2}}{x}$

B) $\lim_{x \to \frac{\pi}{2}} \dfrac{\cos x}{\frac{\pi}{2} - x}$

C) $\lim_{x \to 0} \dfrac{\sin^3 x}{\sin\left(x^3\right)}$

ANSWER: A) 0
B) 1
C) 1

68. Show that $0 \le x - [x] < 1$ for all x. (Here, [x] denotes the greatest integer function.) Then use this inequality with the Squeeze Theorem to evaluate $\lim_{x \to \pi} (x - [x]) \tan x$.

ANSWER: 0

69. Determine a real number c such that the following limit exists, and then evaluate the limit for this value:
$\lim_{x \to 0} \dfrac{3 \sin \frac{x}{2} + (c-1)^2}{\sin x - \cos x + 1}$

ANSWER: $c = 1$; limit is $\dfrac{3}{2}$

70. Evaluate each limit or state that it does not exist:

A) $\lim_{t \to 0} \dfrac{1 - \cos t}{\sqrt{t}}$

B) $\lim_{x \to 0} \dfrac{1 - \cos x}{\sin 2x \sin x}$

C) $\lim_{x \to 0} \dfrac{\sin 2x - \sin x}{x}$

ANSWER: A) 0
B) $\dfrac{1}{4}$
C) 1

71. Evaluate the limits:

A) $\lim_{x \to 0} \dfrac{1 - \cos^4 x}{x^2}$

Copyright Macmillan Learning. Powered by Cognero.

Access Complete Test Bank for Calculus Early Transcendentals 4th Rogawski

Chapter 02

B) $\lim_{x \to 0} \dfrac{\cos\left(x + \frac{\pi}{4}\right) - \sin\left(x + \frac{\pi}{4}\right)}{x}$

ANSWER: A) 2
B) $-\sqrt{2}$

72. Evaluate the limits:

A) $\lim_{x \to 0} \dfrac{\sin 5x}{x^2 - x}$

Hint: Factor the denominator.

B) $\lim_{x \to 0} \dfrac{1 - \cos^2 x}{2x^2 - x}$

Hint: Factor the two expressions.

C) $\lim_{x \to 0} \dfrac{\sin 3x \sin 8x}{x^3 + x^2}$

ANSWER: A) -5
B) 0
C) 24

73. Use the Squeeze Theorem to evaluate the limit

$\lim_{x \to \pi} (1 + \cos x) \sin \dfrac{1}{x}$

ANSWER: 0

74. If $3x^2 - 4 \le f(x) \le x$ on the interval [0,4], then $\lim_{x \to 1} f(x)$ must exist.

a. True
b. False

ANSWER: b

75. Calculate the limits:

A) $\lim_{x \to \infty} \dfrac{2x^5 - x^4 + 1}{8x^5 + x^3 + x - 2}$

B) $\lim_{x \to -\infty} \dfrac{3x^2 + x - 1}{4x - 7}$

C) $\lim_{x \to \infty} \left(\dfrac{6x^3}{2x^2 + 1} - 3x \right)$

ANSWER: A) $\dfrac{1}{4}$
B) $-\infty$

Copyright Macmillan Learning. Powered by Cognero.

Access Complete Test Bank for Calculus Early Transcendentals 4th Rogawski

Chapter 02

C) 0

76. Calculate the limits:

A) $\lim\limits_{x \to -\infty} \dfrac{\sqrt[3]{2x^3 - x + 1}}{\sqrt{x^2 + x - 2}}$

B) $\lim\limits_{x \to \infty} \dfrac{(4x+1)^{15}(3x-1)^{10}}{(9x+7)^5(4x+11)^{20}}$

C) $\lim\limits_{x \to -\infty} \dfrac{\sqrt{|x^2 - 5|}}{x}$

ANSWER: A) $-\sqrt[3]{2}$

B) $\dfrac{1}{1024}$

C) -1

77. Calculate the following limits:

A) $\lim\limits_{x \to -\infty} \dfrac{x^2 + 1}{\sqrt{x^4 - 2}}$

B) $\lim\limits_{x \to -\infty} \dfrac{2x - 1}{\sqrt[3]{x^3 + 1}}$

C) $\lim\limits_{x \to \infty} \left(\sqrt{x^2 - x} - \sqrt{x^2 + 5x}\right)$

ANSWER: A) 1

B) 2

C) -3

78. Compute the following limits:

A) $\lim\limits_{x \to \infty} \dfrac{2x^2 - 6x + 1}{x^2 - 3}$

B) $\lim\limits_{x \to -\infty} \left(-x^5 + 2x^4 - x^2 + 1\right)$

C) $\lim\limits_{x \to -\infty} \dfrac{x^7 - 6x^3 + 1}{2x^7 + x^2 - 2}$

ANSWER: A) 2

B) ∞

C) $\dfrac{1}{2}$

79. Compute the following limits:

Copyright Macmillan Learning. Powered by Cognero.

Access Complete Test Bank for Calculus Early Transcendentals 4th Rogawski

Chapter 02

A) $\lim_{x \to \infty} \frac{3(x+7)^3-(x-7)^3}{2(x+2)^3-(x-2)^3}$

B) $\lim_{x \to -\infty} \frac{x-1}{2x^2+1}$

C) $\lim_{x \to -\infty} \frac{2x^2-6x+1}{x-3}$

ANSWER: A) 2
B) 0
C) $-\infty$

80. Compute the following limits:

A) $\lim_{x \to \infty} x\left(\sqrt{4x^2-1}-2x\right)$

Hint: Multiply and divide by the conjugate expression.

B) $\lim_{x \to -\infty} \frac{2x+7}{\sqrt{x^2-1}}$

Hint: For $x<0$, $\sqrt{x^2}=-x$.

C) $\lim_{x \to \infty} \frac{x^{\frac{5}{3}}-3x^{\frac{2}{3}}}{x^{\frac{18}{5}}+x}$

ANSWER: A) $-\frac{1}{4}$
B) -2
C) 0

81. Compute the following limits:

A) $\lim_{x \to \infty} \left(\frac{1}{x-1}-\frac{2}{x^2-1}\right)$

B) $\lim_{x \to -\infty} \frac{x^3+x^2-2x+1}{1-2x^3}$

C) $\lim_{x \to -\infty} \frac{x^4+2x-1}{x^3+x}$

ANSWER: A) 0
B) $-\frac{1}{2}$
C) $-\infty$

82. Compute the following limits:

Copyright Macmillan Learning. Powered by Cognero.

Access Complete Test Bank for Calculus Early Transcendentals 4th Rogawski

Chapter 02

A) $\lim\limits_{x \to -\infty} \dfrac{1-\sqrt{3+x^2}}{1+\sqrt{4x^2+1}}$

B) $\lim\limits_{x \to \infty} \dfrac{x+3-\sqrt{x^2+2}}{\sqrt{x^2+1}-5}$

(C) $\lim\limits_{x \to \infty} \left(\sqrt{x^2-3x+7}-x\right)$

ANSWER: A) $-\dfrac{1}{2}$

B) 0

C) $-\dfrac{3}{2}$

83. The Intermediate Value Theorem guarantees that the equation $x \cos x - \sin x = 0$ has a solution in which of the following intervals?

a. $(2\pi, 3\pi)$

b. $\left(\dfrac{\pi}{2}, \pi\right)$

c. $\left(\dfrac{3\pi}{2}, 2\pi\right)$

d. $\left(\dfrac{\pi}{4}, \pi\right)$

e. $(\pi, 3\pi)$

ANSWER: a

84. The polynomial $P(x) = x^3 - x - 5$ must have a root in which of the following intervals?

a. $(3, 4)$

b. $(1, 2)$

c. $(0, 1)$

d. $\left(\dfrac{1}{2}, 1\right)$

e. $(-1, 1)$

ANSWER: b

85. Which of the following functions is a counterexample for the converse of the Intermediate Value Theorem, which states: If $f(x)$ assumes all the values between $f(a)$ and $f(b)$ in the interval $[a, b]$, then f is continuous on $[a, b]$.

Copyright Macmillan Learning. Powered by Cognero.

Access Complete Test Bank for Calculus Early Transcendentals 4th Rogawski

Chapter 02

a. $f(x)=x-1$ on $[0, 2]$

b. $f(x)=\dfrac{1}{x-1}$ on $[0, 2]$

c. $f(x)=\dfrac{\sin x}{x}$ on $(0, 2), f(0)=1 f(x)=\begin{cases}\dfrac{\sin x}{x}, 0<x\leq 2\\ 1, x=0\end{cases}$ on [0,2]

d. $f(x)=[x]$ on $[0, 2]$ (Here, $[x]$ denotes the greatest integer function.)

e. $f(x)=\dfrac{1}{(x-1)^2}$ on $[-3, 2]$

ANSWER: e

86. Which of the following functions has a zero in the interval $[-1, 3]$?

a. $f(x)=\dfrac{x}{x-4}$

b. $f(x)=x^2-3x+3$

c. $f(x)=\dfrac{x^2}{x-2}$

d. $f(x)=\cos\dfrac{x}{\pi}$

e. Both A and C

ANSWER: e

87. The Intermediate Value Theorem guarantees that the equation $\tan x=x$ has a solution in which of the following intervals?

a. $\left[-\dfrac{\pi}{8}, \dfrac{3\pi}{8}\right]$

b. $\left[\dfrac{\pi}{4}, \dfrac{3\pi}{4}\right]$

c. $\left[-\dfrac{\pi}{4}, \dfrac{\pi}{4}\right]$

d. $\left[\dfrac{\pi}{4}, \pi\right]$

e. Both A and C

ANSWER: e

88. Which of the following functions is a counterexample for the converse of the Intermediate Value Theorem, which states: If $f(x)$ assumes all the values between $f(a)$ and $f(b)$ in the interval $[a, b]$, then f is continuous on

Copyright Macmillan Learning. Powered by Cognero.

Access Complete Test Bank for Calculus Early Transcendentals 4th Rogawski

Chapter 02

$[a, b]$.

a. $f(x) = x^2$ for $x \in (1, 3)$, $f(1) = 9$, $f(3) = 1$ on [1,3]

b. $f(x) = \dfrac{1}{x-2}$ on $[1, 3]$

c. $f(x) = \dfrac{1-\cos x}{x}$ on $\left(0, \dfrac{\pi}{2}\right]$, $f(0) = 0$ on $\left[0, \dfrac{\pi}{2}\right]$

d. $f(x) = [x]$ on $[1, 3]$ (Here, [x] denotes the greatest integer function.)

e. Both A and C

ANSWER: a

89. Which of the following functions is a counterexample for the converse of the Intermediate Value Theorem: If f assumes all the values between $f(a)$ and $f(b)$ in the interval $[a, b]$, then f is continuous on $[a, b]$.

a. $f(x) = \dfrac{1}{x-1}$ if $1 < x \le 3$, $f(1) = 2$ on [1,3]

b. $f(x) = [x]$ on $1 < x \le 3$ (Here, [x] denotes the greatest integer function.)

c. $f(x) = \dfrac{1}{x-4}$ on $1 < x \le 3$

d. $f(x) = x^2$ for $1 < x \le 3$ and $x \ne 2$, $f(2) = 1$

e. Both A and D

ANSWER: a

90. Assume $g(x)$ is continuous on $[-3, 9]$, $g(-3) = 14$, and $g(9) = 72$. Determine whether each of the following statements is always true, never true, or sometimes true.

A) $g(c) = 0$: no solution with $c \in [-3, 9]$

B) $g(c) = 60$: no solution with $c \in [-2, 9]$

C) $g(c) = 21$: no solution with $c \in [-3, 9]$

D) $g(c) = -1,000,000$: exactly one solution with $c \in [-2, 9]$

E) $g(c) = 49.5$: a solution with $c \in [-3, 9]$

ANSWER: A) Sometimes true
B) Sometimes true
C) Never true
D) Sometimes true
E) Always true

91. Draw the graph of a function $g(x)$ on $[-2, 2]$ such that the graph does not satisfy the conclusion of the Intermediate Value Theorem.

ANSWER: Answers may vary. A sample answer is:

Copyright Macmillan Learning. Powered by Cognero.

Access Complete Test Bank for Calculus Early Transcendentals 4th Rogawski

Chapter 02

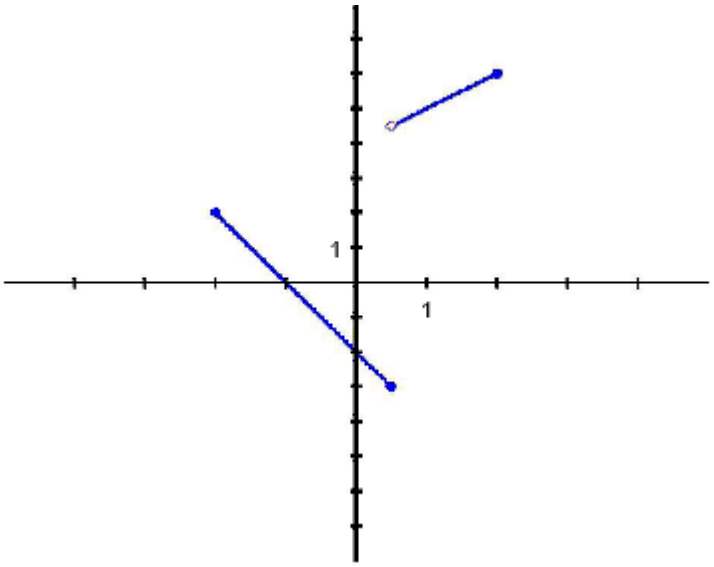

92. Which of the following properties can be used to prove that $f(x) = \cos x$ is continuous for all x?

a. $|\cos x| \le 1$ for all x

b. $|\cos x - \cos y| \le |x - y|$ for all x and y

c. $\cos x - \cos y \le x - y$ for all x and y

d. The limit $\lim_{x \to 0} \frac{1 - \cos x}{x}$ exists

e. $|\cos x - \cos y| \ge |x - y|$ for all x and y

ANSWER: b

93. Which of the following statements imply that $\frac{1}{x}$ is not continuous at $x = 0$?

a. $\frac{1}{x}$ has opposite signs on the two sides of $x = 0.$

b. $|\frac{1}{x}| < 0.01$ implies that $x > 100.$

c. For any $\varepsilon > 0$, $|\frac{1}{x}| < \varepsilon$ implies that $|x| > \frac{1}{\varepsilon}$.

d. If $x < \varepsilon$, then $|\frac{1}{x}| < \frac{1}{\varepsilon}$.

e. A and C are correct.

ANSWER: c

94. To show that L is not the limit of $f(x)$ as $x \to x_0$, we should show that:

Copyright Macmillan Learning. Powered by Cognero.

Access Complete Test Bank for Calculus Early Transcendentals 4th Rogawski

Chapter 02

a. For any $\varepsilon > 0$, there exists $\delta > 0$ such that if $|x - x_0| > \delta$ then $|f(x) - L| < \varepsilon$.

b. For any $\varepsilon > 0$, there exists $\delta > 0$ such that if $|x - x_0| > \delta$ then $|f(x) - L| > \varepsilon$.

c. There exists $\varepsilon > 0$, such that for any $\delta > 0$ the inequalities $0 < |x - x_0| < \delta$ and $|f(x) - L| \geq \varepsilon$ have a solution x.

d. There exist $\varepsilon > 0$ and $\delta > 0$ such that if $0 < |x - x_0| < \delta$, then $|f(x) - L| > \varepsilon$.

e. A and C are both correct.

ANSWER: c

95. Suppose there exists a value of $\varepsilon > 0$ so that for any value of $\delta > 0$, we can find a value of x satisfying $0 < |x - x_0| < \delta$ and $|f(x) - L| > \varepsilon$. We may conclude that:

a. L is the limit of f as $x \to x_0$.

b. L is not the limit of f as $x \to x_0$.

c. The limit of f as $x \to x_0$ does not exist.

d. The limit of f as $x \to x_0$ exists but is not equal to L.

e. None of the above.

ANSWER: b

96. To show that L is not the limit of $f(x)$ as $x \to x_0$, we should show that:

a. There exists $\varepsilon > 0$ such that for any $\delta > 0$ there exists a solution to the inequalities $|x - x_0| < \delta$ and $|f(x) - L| > \varepsilon$.

b. There exists $\varepsilon > 0$ such that for any $\delta > 0$ there exists a solution to the inequalities $|x - x_0| > \delta$ and $|f(x) - L| < \varepsilon$.

c. There exists $\delta > 0$ such that for any $\varepsilon > 0$, if $|f(x) - L| < \varepsilon$, then $|x - x_0| < \delta$.

d. For any $\varepsilon > 0$ and $\delta > 0$, if $|x - x_0| < \delta$, then $|f(x) - L| > \varepsilon$.

e. A and D are both correct.

ANSWER: a

Copyright Macmillan Learning. Powered by Cognero.

Access Complete Test Bank for Calculus Early Transcendentals 4th Rogawski